MODUL 10
MATEMATIK TINGKATAN 1

NAMA : _____ **KELAS:** _____

8.2b Menentukan nilai sudut pada garis bersilang.

1. Cari nilai x dan y

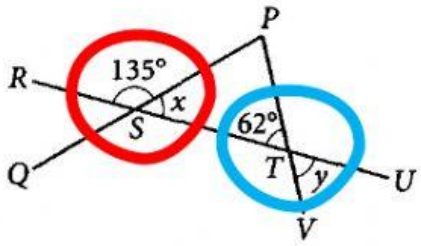

Penyelesaian :

Fokus pada sudut x yang hendak dicari.

x ialah sudut _____

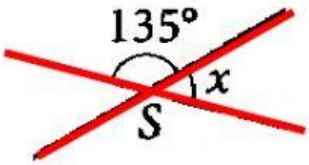

Maka, x = _____ _____ _____

x = _____

Fokus pada sudut y yang hendak dicari.

y ialah sudut _____

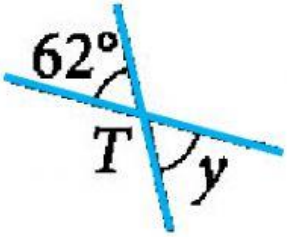

maka, y = _____

LIVEWORKSHEETS

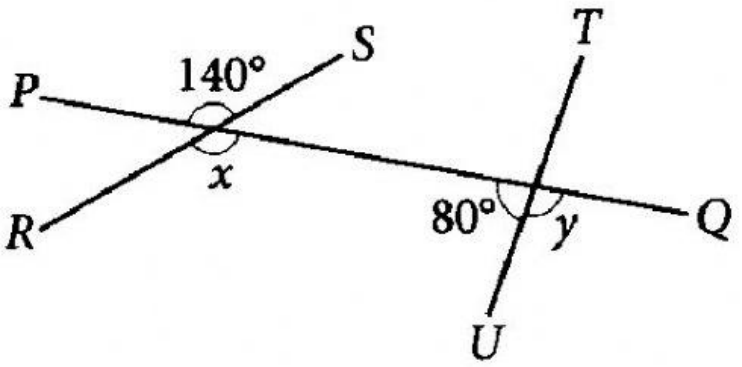

Arahan :

Pilih jalan kerja yang betul

Nilai x	Nilai y
x = 140°	y = 80°
x = 180° - 140° x = 40°	y = 180° - 80° y = 100°

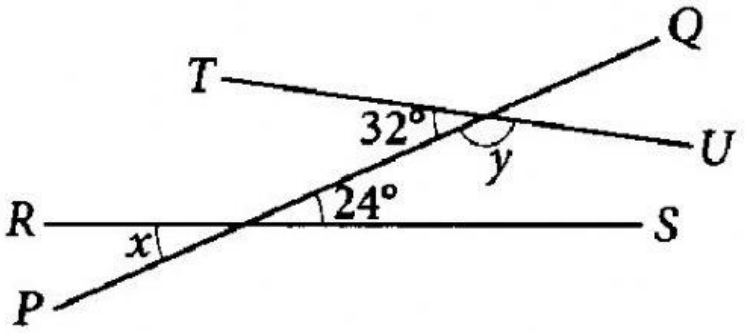

Nilai x	Nilai y
x = 24°	y = 32°
x = 180° - 24° x = 156°	y = 180° - 32° y = 148°

LIVEWORKSHEETS