PRACTIQUEM LA SUMA

1. Compta els cubets que afegim a la torre blava en cada cas i suma.



5 + ____ = ____



4 + ____ = ____

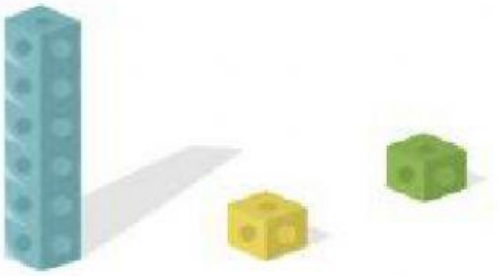

6 + ____ = ____



3 + ____ = ____

LIVEWORKSHEETS