Khamis **14 Oktober 2021**

Kira isipadu bagi setiap rajah berikut.

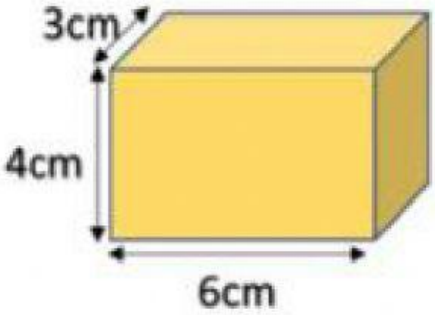

4 cm X ☐ cm X 6 cm = ☐ cm^3

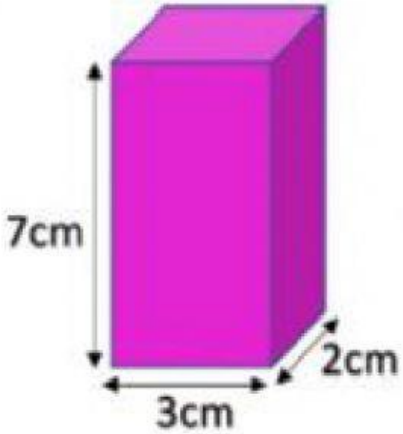

2 cm X 3 cm X ☐ cm = ☐ cm^3

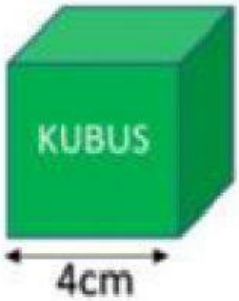

☐ cm X ☐ cm X ☐ cm= ☐ cm^3

Salmiah Mohd Nasir
6 Cemerlang Al-Jazari

LIVEWORKSHEETS