MATHS TEST 1-1ST TERM

Grade 4

1 Complete the fractions:

a) Two quarters $\frac{2}{\square}$ b) A third $\frac{\square}{\square}$ c) Four fifths $\frac{4}{\square}$ d) A half $\frac{1}{\square}$

e) Four eighths $\frac{4}{\square}$ f) Six sevenths $\frac{\square}{7}$ g) Three ninths $\frac{\square}{\square}$

2 Write the fraction and the name for the shaded area of each shape:

a)

b) 

c)

d)

$\frac{\square}{\square}$ ☐ $\frac{\square}{\square}$ ☐ $\frac{\square}{\square}$ ☐ $\frac{\square}{\square}$ ☐

3 Link:

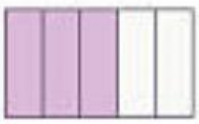
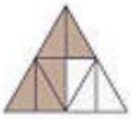

Eight thirteenths Two thirds Three quarters

Three fifths Five eighths Seven tenths

4 Write the following fractions:

$\frac{3}{2}$ ☐ $\frac{7}{5}$ ☐ $\frac{9}{4}$ ☐


☐

☐

LIVEWORKSHEETS