GRADE 3 SUB MATH REEFA'A SCHOOL C-1 UNIT 3 LESSON 2 USE ARRAYS TO MULTIPLY

DATE: **NAME:**

I. **Write the addition & multiplication equation for the given array:**

A.

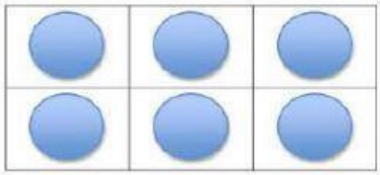

Addition Equation: _____ + + + = _____

Multiplication Equation: _____ × = _____

B.

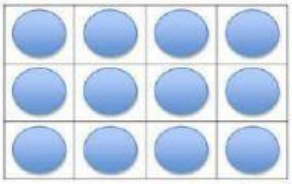

Addition Equation: _____ + + + + = _____

Multiplication Equation: _____ × = _____

C.

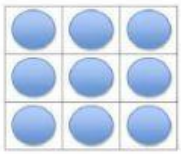

Addition Equation: _____ + + + = _____

Multiplication Equation: _____ × = _____

LIVEWORKSHEETS

GRADE 3 SUB MATH REEFA'A SCHOOL C-1 UNIT 3 LESSON 2 USE ARRAYS TO MULTIPLY

DATE: **NAME:**

D.

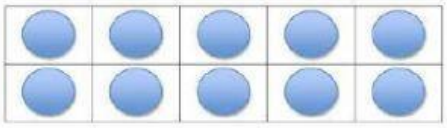

Addition Equation: _____ + + + + + =

Multiplication Equation: _____ × =

E.

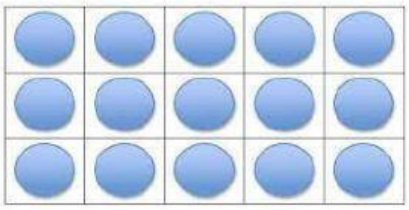

Addition Equation: _____ + + + =

Multiplication Equation: _____ × =

F.



Addition Equation: _____ + + + + =

Multiplication Equation: _____ × =

LIVEWORKSHEETS