Grade 5 Unit 22 Area and Perimeter of Irregular Shape

(1) Find the Area of the shapes below

1.

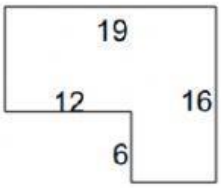

3.

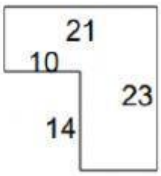

5.

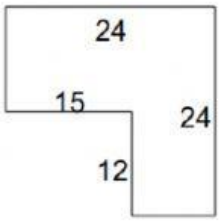

2.

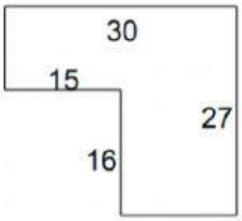

4.

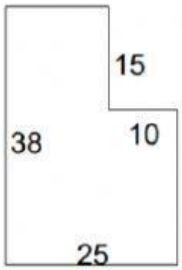

6.

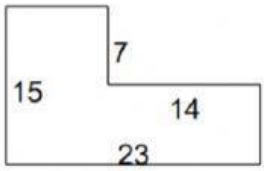

(2) Find the perimeter of the shapes below

Find the perimeter and area.

1.

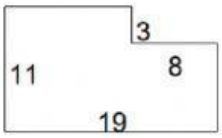

3.

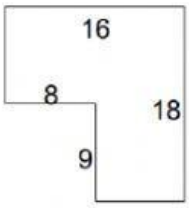

5.

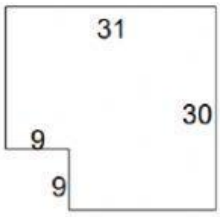

2.

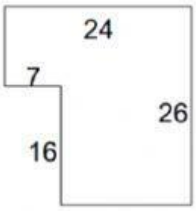

4.

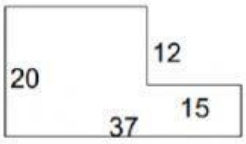

6.

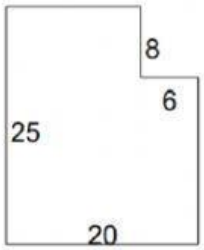

LIVEWORKSHEETS

(3) Find the Perimeter and Area of the shapes below

Find the perimeter and area.

1.

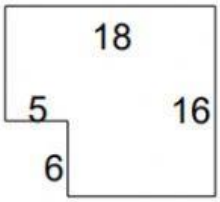

3.

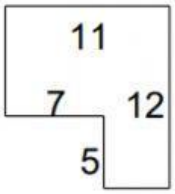

5.

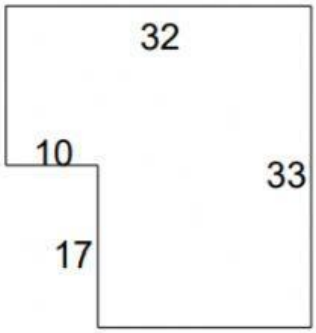

2.

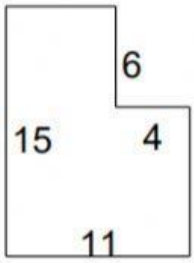

4.

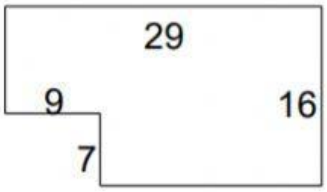

6.

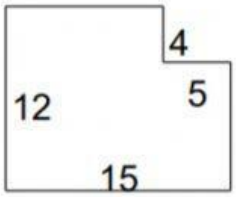

LIVEWORKSHEETS