KAÇ TANE ?

Kartlardaki hayvanların kaç tane olduklarını sayıp alt olduğu rakamı seçiniz...



5
4
3



9
8
7



2
3
4



7
8
9



2
3
4

1
2
3



4
5
6

3
2
1



6
7
8

LIVEWORKSHEETS