English Table of Weight Measures

worksheet 41

16 ounces (oz.) = 1 pound (lb.)
2,000 pounds = 1 ton (t.)

1. Fill in the blanks.

a. 1 ft. = _____ in. **b.** 1 yd. = _____ in. **c.** 1 t. = _____ lb.

d. 1 lb. = _____ oz. **e.** 1 yd. = _____ ft. **f.** 3 ft. = _____ yd.

2. Solve these measurement equations.

a. 3 t. = _____ lb. **b.** 31 lb. = _____ oz. **c.** 27 ft. = ____ yd.

d. 6 t. + 24 lb. = _____ lb. **e.** 23 in. + 3 ft. = _____ in.

3. Solve this story problem.

The bookstore sold 37 copies of the book *Charlotte's Web* last week for $6.95 each. How much did the bookstore receive for them?

Review

4. Multiply and check.

a. $\begin{array}{r} 87 \\ \times 52 \\ \hline \end{array}$ **b.** $\begin{array}{r} 65 \\ \times 98 \\ \hline \end{array}$ **c.** $\begin{array}{r} 27 \\ \times 45 \\ \hline \end{array}$

LIVEWORKSHEETS

5. Subtract and check.

a. 1,659
− 853

b. 9,051
− 8,748

c. $29.83
− 18.95

6. Add and check.

c. $3.05
6.52
9.87
+ 2.95

7. Divide and check.

a. $4\overline{)832}$

b. $6\overline{)378}$

c. $2\overline{)886}$

8. Multiply each number by 9.

8 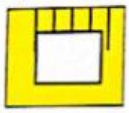

6 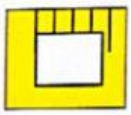

9 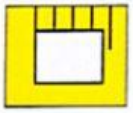

12

4 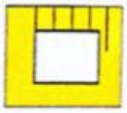

11. Fill in the blanks.

a. 36 ÷ 4 = ____

b. 18 ÷ 3 = ____

c. 18 − 9 = ____

d. 4 × 6 = ____

e. 9 × 5 = ____

f. 4 + 8 = ____

g. 9 + 7 = ____

h. 6 × 8 = ____

i. 9 × 3 = ____

j. (5 + 3) − 1 = ____

k. (7 × 2) ÷ 2 = ____

l. (7 + 2) − 4 = ____

LIVEWORKSHEETS