Name: _____ Date: _____

Mathematics

Multiplication Strategies: Box Method (Paper 2)

Example:

$$\begin{array}{r} 345 \\ \times \quad 53 \\ \hline 18285 \end{array}$$

	300	40	5
50	15000	2000	250
3	900	120	15

Add the partial products

$$\begin{array}{r} 15000 \\ 2000 \\ 900 \\ 250 \\ 120 \\ +\quad 15 \\ \hline 18285 \end{array}$$

(final product or answer)

Work out the answers to these multiplication questions using the box method.

1. 92 × 7 = _____

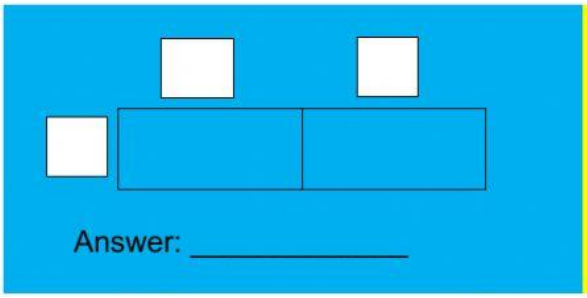

Answer: _____

5. 277 × 8 = _____

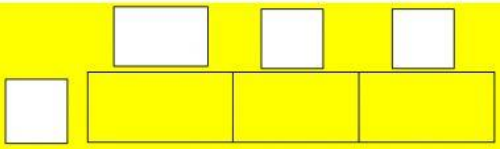

Answer: _____

2. 63 × 42 = _____

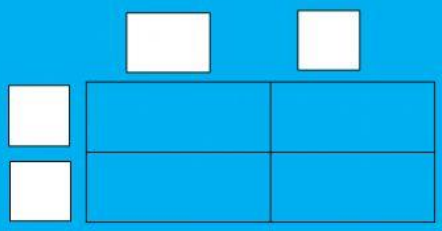

Answer: _____

6. 82 × 37 = _____

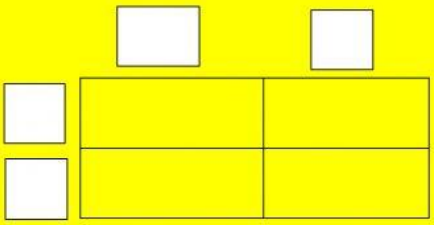

Answer: _____

3. 847 × 26 = _____

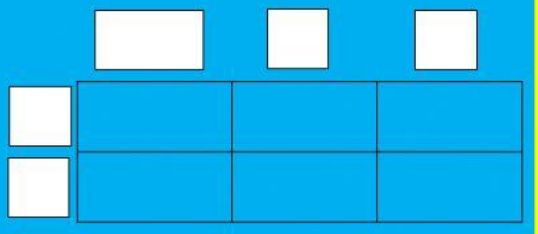

Answer: _____

7. 978 × 95 = _____

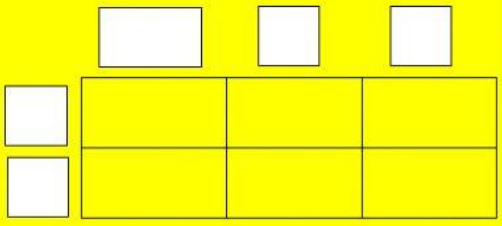

Answer: _____

LIVEWORKSHEETS

4. 7235 × 6 = _____

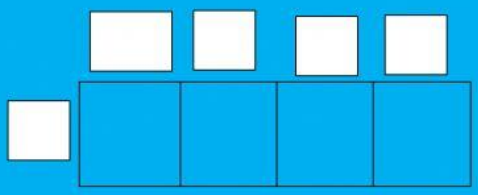

Answer: _____

8. 5948 × 72 = _____

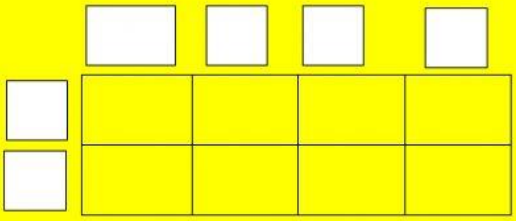

Answer: _____

Remember: Always check your answers!

LIVEWORKSHEETS