Isi tempat kosong dan namakan jenis tanah di dalam balang.

butir-butir tanah yang sangat halus	butir pasir	batu kecil	tumbuhan reput
	tanah liat	tanah kebun	pasir

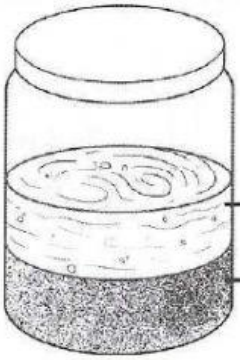

air

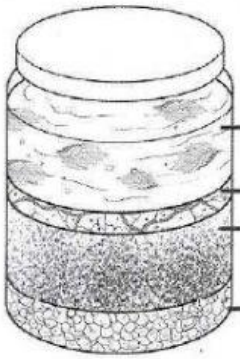

haiwan reput

batu-batu kecil

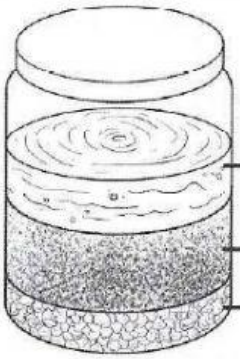

air

butir-butir pasir

LIVEWORKSHEETS

Asingkan Kandungan Tanah

Tarikh:

Aktiviti 5

Gambar di bawah menunjukkan kandungan sejenis tanah. Tuliskan kandungan tanah yang betul.

daun kering	haiwan kecil	ranting kayu	batu	butir pasir

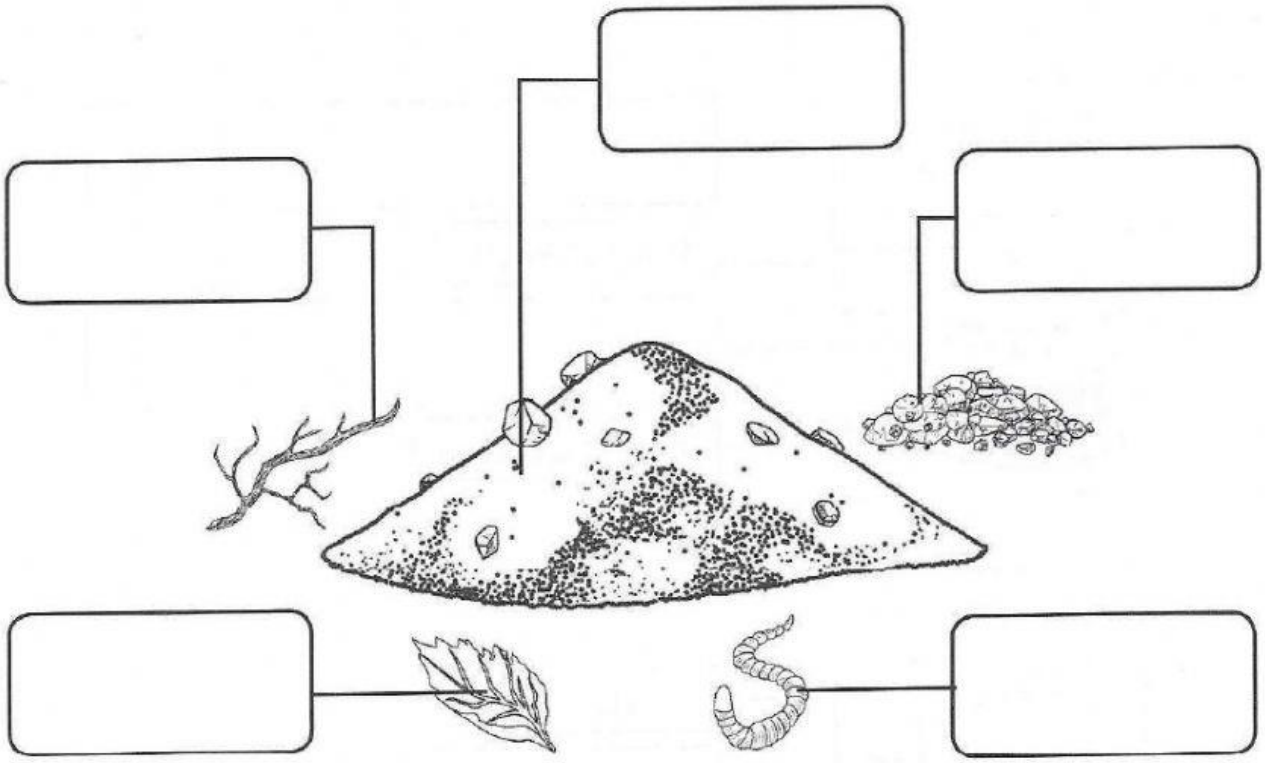

Tanah ini ialah _____.

9.2.1
9.2.3

Buku Teks
Halaman:
85-87

LIVEWORKSHEETS