ANGLES IN A QUADRILATERAL 1

Remember that the angles in a quadrilateral add up to 360°. The angles are not drawn to scale, so do not try to measure them!

Find the value of each angle marked with a "?"

1)

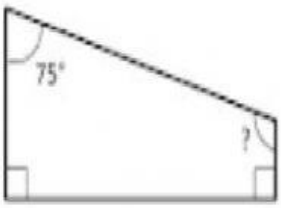

2)

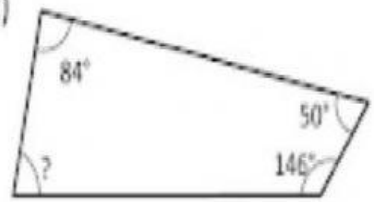

3)

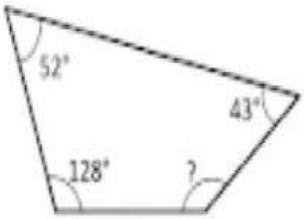

4)

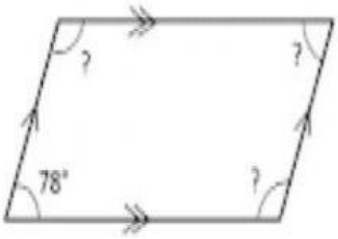

5)

6)

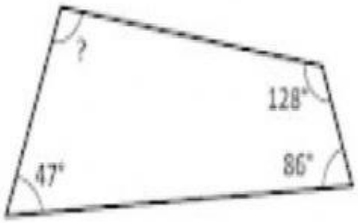

7) A rhombus

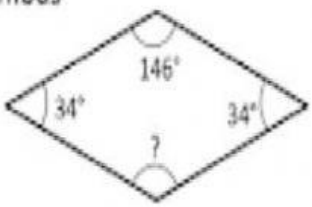

8)

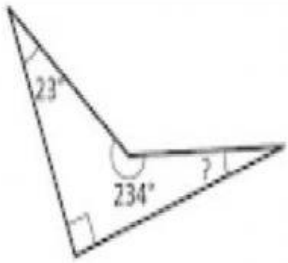

LIVEWORKSHEETS