Name Class2/ No.

Fill in the correct answer.



g

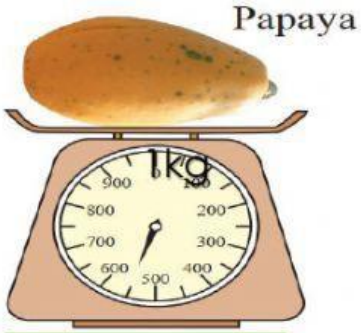

g

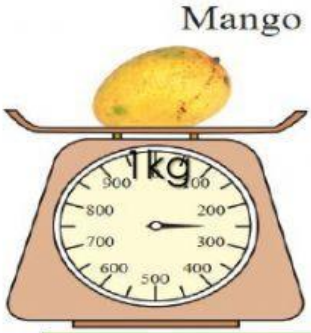

g

kg



kg



kg g

Use the word below to fill in the blanks.

heavier heaviest lighter lightest

1. The mango is _____ than the papaya.

2. The grapes are _____ than the mango.

3. The bananas are the _____.

4. The Mango is the _____.

LIVEWORKSHEETS

Matching the correct answer.

1. 2 kilograms.	A. 1 kilograms
2. 4 kilograms.	B. 2,000 grams
3. 5000 grams.	C. 4,000 grams
4. 1000 gams.	D. 5 kilograms

Fill in the correct answer

1.

Kg	g
18	350
+ 5	120

2.

Kg	g
25	793
- 13	635

3. John had 200 grams of rice. He cooked 70 grams of it. How much rice did he have left?

Answer: _____ grams.

4. Father bought 7 kilograms of apples, 12 kilograms of bananas and 14 kilograms of cherries. What was the total mass of the fruits he bought?

Answer: _____ kilograms.

LIVEWORKSHEETS