NAMA:_____

KELAS:_____

Tulis ayat matematik tambah berdasarkan gambar

*Write the number sentences for addition based on the pictures*

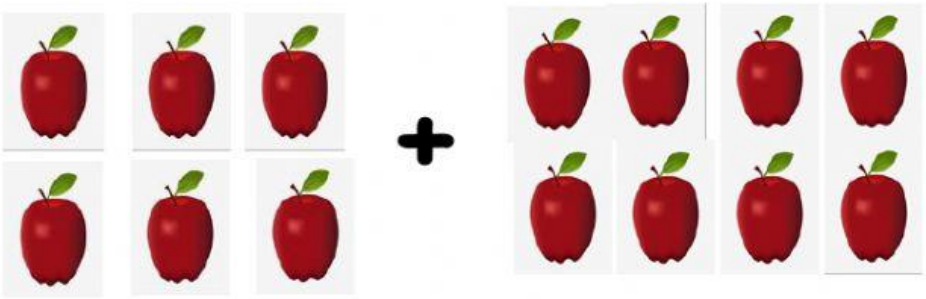

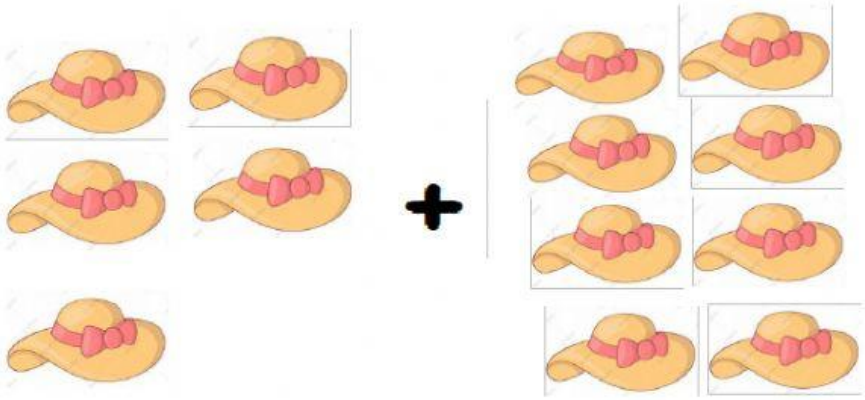



LIVEWORKSHEETS

**Tulis ayat matematik tolak berdasarkan gambar**

*Write the number sentences for subtraction based on the pictures*

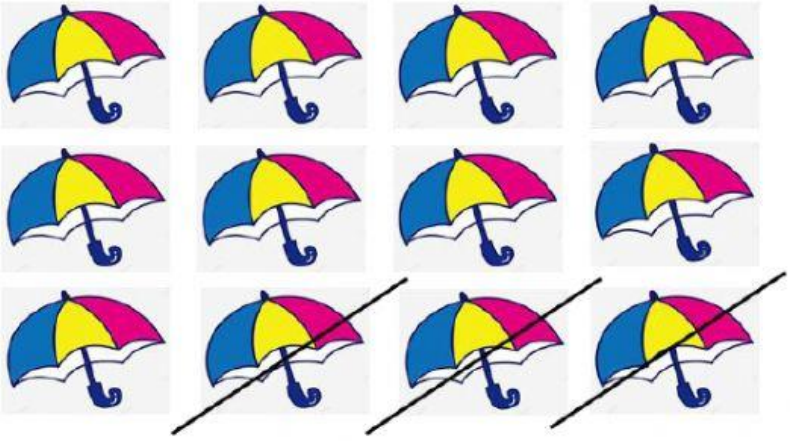

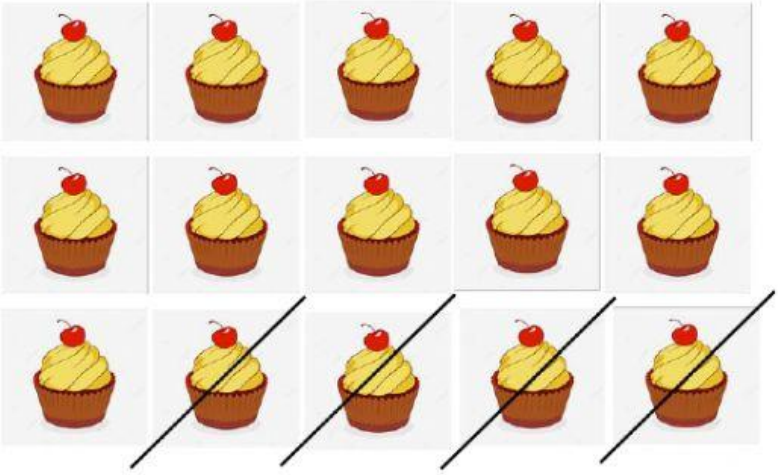



LIVEWORKSHEETS

Padankan kumpulan objek berikut dengan nombor yang betul

*Match the following sets of objects with the corrects numbers*



9



18

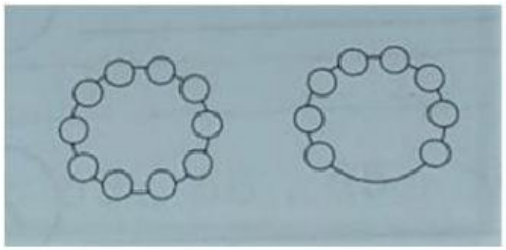

47



36

LIVEWORKSHEETS

Bandingkan dua nombor dan tulis "lebih daripada" atau"kurang daripada"

*Compare two numbers and write "more than" or "less than" in the blanks*

| | | |
|---|---|---|
| 7 | | 4 |
| 15 | | 18 |
| 68 | | 64 |
| 72 | | 79 |

LIVEWORKSHEETS

Lengkapkan yang berikut

*Complete the following*

| | |
|---|---|
| 7 + 1 = | 10 |
| 4 + 5 = | 8 |
| 6 + 1 = | 9 |
| 2 + 8 = | 7 |
| 2 + 4 = | 6 |

LIVEWORKSHEETS

Isi tempat kosong

*Fill in the blanks*

RM 1 =

RM 5 =

RM 10 =

50 Sen =

LIVEWORKSHEETS