UNIT 9

BUMI

Tarikh:

Aktiviti 1

Kenali Bentuk Muka Bumi

Tuliskan bentuk muka bumi yang betul bagi gambar yang berikut.

sungai | bukit | pantai | kolam









9.1.1

Buku Teks Halaman: 82-83

LIVEWORKSHEETS