Name _____

Reteach to Build Understanding
2-2

Vocabulary

1. Write the number for each model.

If you *can* skip count squares by 2s, the number is **even**.
If you *can't* skip count squares by 2s, the number is **odd**.

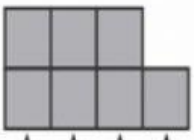

2, 4, 6, +1

The number is _____.

You *can't* skip count by 2s.

The number is _____.

This model shows the equation 3 + 4 = _____.

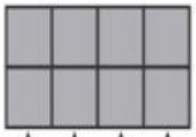

2, 4, 6, 8

The number is _____.

You *can* skip count by 2s.

The number is _____.

This model shows the equation _____ + _____ = _____.

2. Write the number for each model. Circle even or odd. Then write the equation.



10

even odd

5 + 5 = 10



_____

even odd

_____ + _____ = _____



_____

even odd

_____ + _____ = _____

LIVEWORKSHEETS