CALCULATE AREA

Find the area of each figure shown.

	Question	Answer
1	Square 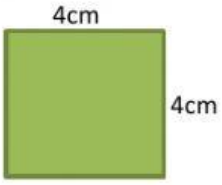	The area of this square is
2	Rectangle 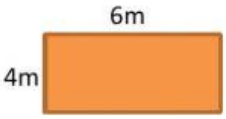	The area of this rectangle is
3	Square 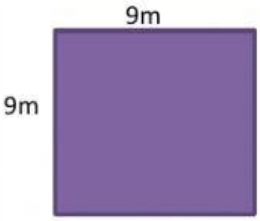	The area of this square is
4	Rectangle 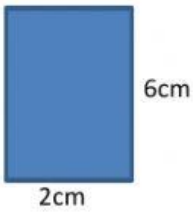	The area of this rectangle is
5	Triangle 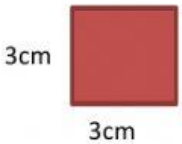	The area of this square is

LIVEWORKSHEETS

	Question	Answer
6	Rectangle 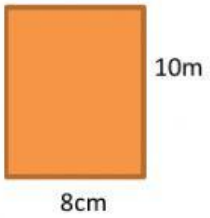	The area of this rectangle is
7	Rectangle	The area of this rectangle is
8	Square 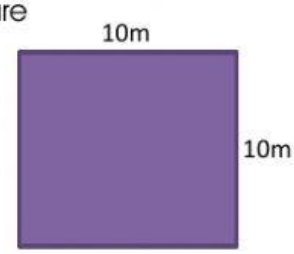	The area of this square is
9	Rectangle 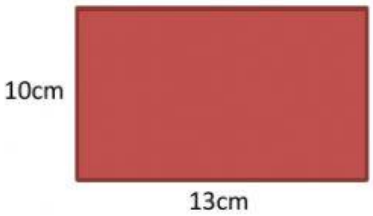	The area of this rectangle is
10	Rectangle 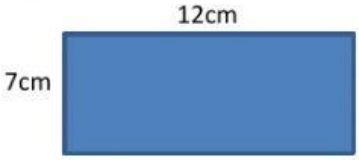	The area of this rectangle is

LIVEWORKSHEETS