Addition Sentences

Instructions: Count the objects in each group. Type the addend under each picture, then add and type the sum.

1.



+





2.



+



3.

+



4.

+





LIVEWORKSHEETS