LEMBAR KERJA MATEMATIKA

Nama :
Kelas :
No Absen :

1. Pilihlah nama bagian pada lingkaran berikut!

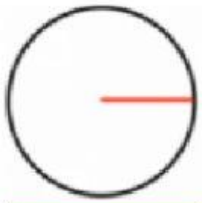

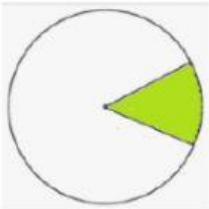

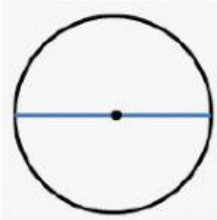

2. Perhatikan gambar lingkaran berikut ini!
   Pasangkan bagian kiri dengan bagian kanannya!

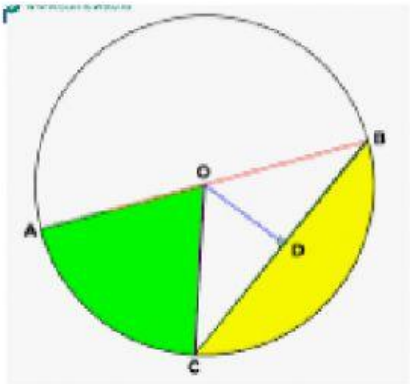

AB ■	■ Apotema
OA, OB, OC ■	■ Diameter
OD ■	■ Busur
BC ■	■ Jari – jari
$\overset{\frown}{BC}$ ■	■ Tali Busur

3. Tentukan panjang diameter dari lingkaran berikut ini!

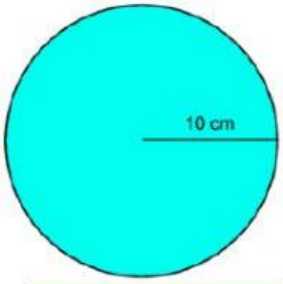

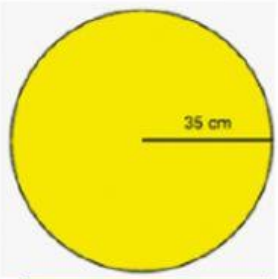

4. Tentukan panjang jari-jari dari lingkaran yang berdiameter sebagai berikut!

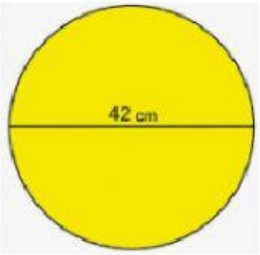

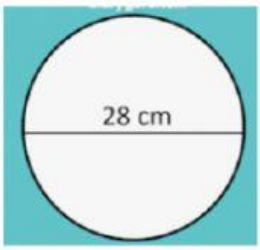

LIVEWORKSHEETS