LIFE INTERNATIONAL SCHOOL

QUARTER 1 EXAM IN SCIENCE

Grade 1B

Name: _____ Date: _____ Score: _____/ 35

A. Arrange the rumble piece of picture into a Flower. (4 points)

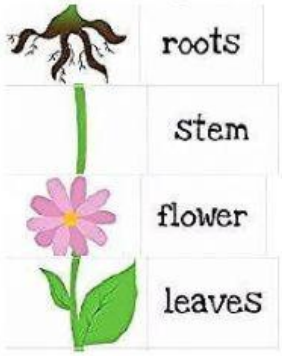

B. What do plants need to grow? Matching type. (4 points)



sun

air

soil

water

LIVEWORKSHEETS

C. **Match the pictures of different types of plant by listening to audio. (4 points)**

	bushes
	tree
	grass
	flower

D. Arrange the plant life cycle. (4 points)

1	2
3	4

LIVEWORKSHEETS

E. Matching type. Connect the body part on its name (5 points)

At the farm



wings

teeth

feet

feathers

ears

F. Find which group does the animals belong. (6 points)

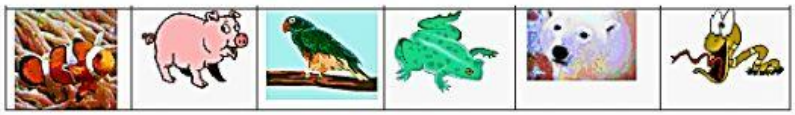

Insects		
Amphibians		
Mammals		
Fish		
Reptiles		
Birds		

LIVEWORKSHEETS

G. Drag the pictures which group it belongs at. (8 points)

living	non-living

Great Job, you did it!

Jesus Loves You!

LIVEWORKSHEETS