Legkapkan data pada setiap bentuk 3 dimensi di bawah dan cari isipadu mereka.

Rumus isipadu : panjang x lebar x tinggi

1) kubus

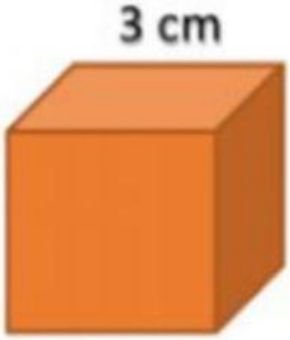

Panjang : _____ cm

Lebar : _____ cm

Tinggi : _____ cm

Isipadu = panjang x lebar x tinggi

= _____ cm x _____ cm x _____ cm

= _____ cm^3

2) kuboid

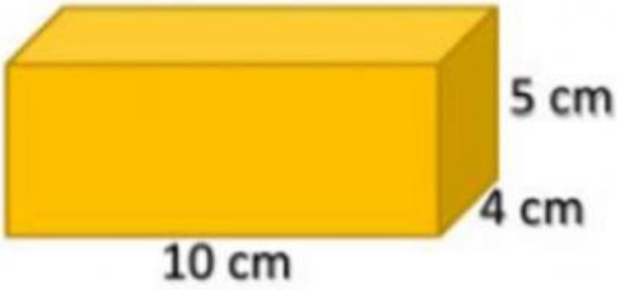

Panjang : _____ cm

Lebar : _____ cm

Tinggi : _____ cm

Isipadu = panjang x lebar x tinggi

= _____ cm x _____ cm x _____ cm

= _____ cm^3

3) [ ]

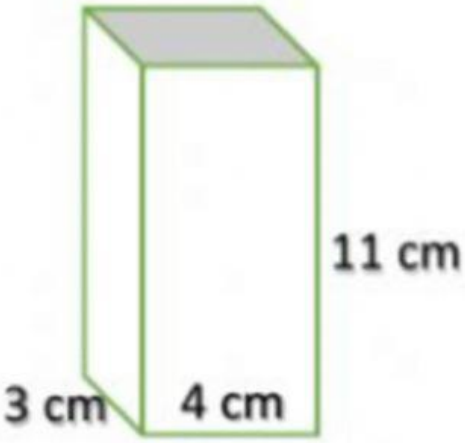

Panjang : _____ cm

Lebar : _____ cm

Tinggi : _____ cm

Isipadu = panjang x lebar x tinggi

= _____ cm x _____ cm x _____ cm

= _____ cm^3

LIVEWORKSHEETS

4)

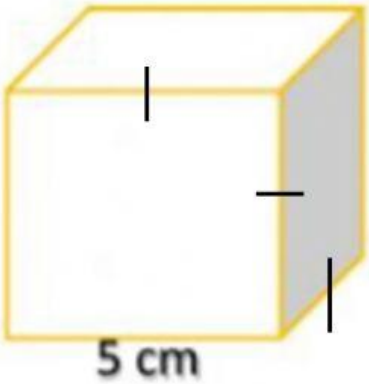

Panjang : _____ cm

Lebar : _____ cm

Tinggi : _____ cm

Isipadu = panjang x lebar x tinggi

= _____ cm x _____ cm x _____ cm

= _____ cm^3

5)

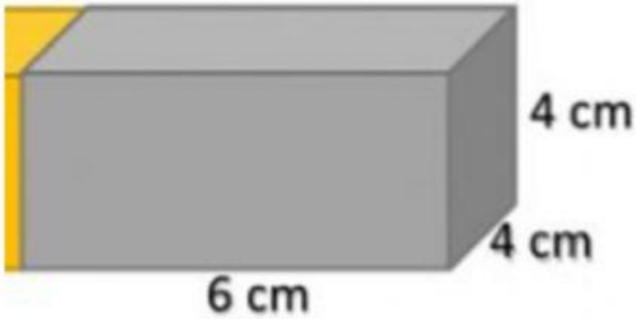

Panjang : _____ cm

Lebar : _____ cm

Tinggi : _____ cm

Isipadu = panjang x lebar x tinggi

= _____ cm x _____ cm x _____ cm

= _____ cm^3

6)

Panjang : _____ cm

Lebar : _____ cm

Tinggi : _____ cm

Isipadu = panjang x lebar x tinggi

= _____ cm x _____ cm x _____ cm

= _____ cm^3

LIVEWORKSHEETS