ÁREA DE UN CÍRCULO

NOMBRES:

Halla el área de los siguientes círculos:

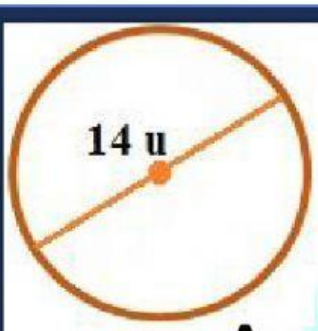

$A_o = \pi R^2$

$A_o = \pi$

$A_o = \pi$

$A_o =$ π

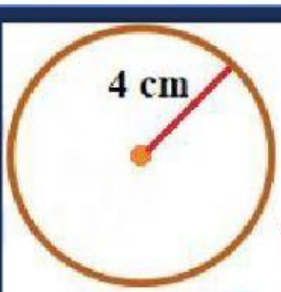

$A_o = \pi R^2$

$A_o = \pi$

$A_o = \pi$

$A_o =$ π

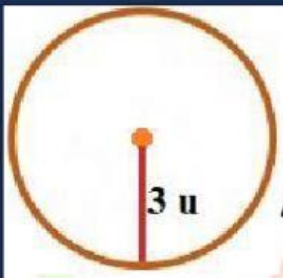

$A_o = \pi R^2$

$A_o = \pi$

$A_o = \pi$

$A_o =$ π

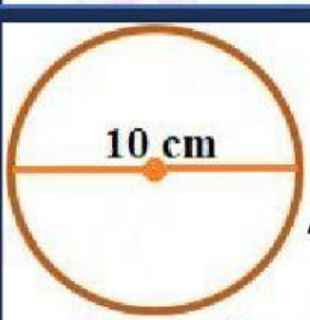

$A_o = \pi R^2$

$A_o = \pi$

$A_o = \pi$

$A_o =$ π

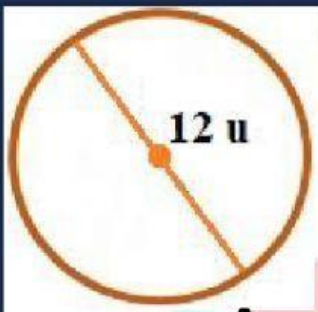

$A_o = \pi R^2$

$A_o = \pi$

$A_o = \pi$

$A_o =$ π

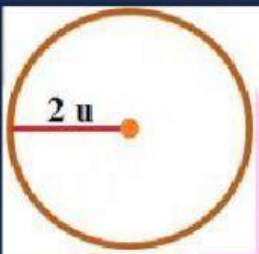

$A_o = \pi R^2$

$A_o = \pi$

$A_o = \pi$

$A_o =$ π

LIVEWORKSHEETS