Name: _____ **Section:** _____

Learning Task 1: Balanced or Unbalanced?

Part A.

Directions: Identify the situation if it shows balance or unbalanced force.



1. pulling a rope

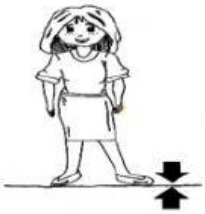

2. standing still



3. tug of war

4. sky diving

Part B: Differentiate balanced from unbalanced forces.

BALANCED FORCES

UNBALANCED FORCES

LIVEWORKSHEETS