Add to 10 with Images: The Flying Birds

How many red birds are there?

a. 1

b. 2

c. 3

d. 4



Challenge 2/5

How many blue birds are there?

a. 1

b. 2

c. 3

d. 4



LIVEWORKSHEETS

Challenge 3/5

If you add the number of red birds with the number of blue birds, how many birds do you have altogether?

Type answer here



Challenge 4/5

Suppose the blue birds were yellow instead of blue. Now if you add the number of red birds with the number of yellow birds, how many birds would you have altogether?

Type answer here



Challenge 5/5

Open Discussion: Suppose that you added the number of blue birds first, then the number of red birds second. Would the answer still be 3? Why or why not?

Discuss your answer with others.



LIVEWORKSHEETS