Name: _____

Addition Stories

1. Circle the correct answer.

Anna draws 4 red stars and 6 blue stars.

How many stars does she draw in all?

a. Which is the model of the problem?

A. 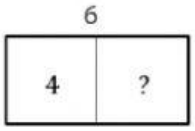

B. 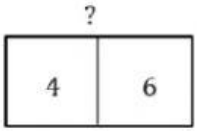

C. 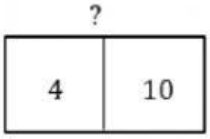

b. Choose the number sentence to solve the problem.

A. $4 + 6 = 10$ B. $4 + 6 = 9$ C. $6 - 4 = 2$

c. Choose the right answer for the problem.

A. She draws 10 stars in all. B. She draws 9 stars in all. C. She has 2 stars left.

Solve the problems.

2. Mike has 5 fish in his tank. Then he has 7 more fish.

How many fish does Mike have in all?

• *Find?* Fish _____ • *Know?* fish more fish	• *Draw the model.*	• *Write the number sentence.* ____ + ____ = ____ • *Write the answer.* Mike has ____ fish in all.

3. There are 7 red roses, 8 yellow roses, 3 white roses.

How many flowers are there in all?

• *Find?* Flowers _____ • *Know?* white roses red roses yellow	• *Draw the model.*	• *Write the number sentence.* ____ + ____ + ____ = ____ • *Write the answer.* There are ____ flowers in all.

LIVEWORKSHEETS