Tagore International School
Vasant Vihar
Interactive Worksheet-4
Class: 4

Name: .....
Date: .....

Find the missing digits

4927 -3□15 131□	29□4 -134□ □□22	74□9 -3□61 □33□	□3□□ -4175 2□22
93□1 -7□4□ □960	2□76 -147□ □0□9	7□3□ -4438 □5□1	5431 -3□□0 □031
9742 -□□□□ 5331	76□□ -□□44 3240	3□□1 -2340 □451	539□ -□□43 1153

Spot the Error!

Rolly, Polly & Molly were given a statement question by their teacher to solve. Find out who solved it correctly. Also, mention the mistake/mistakes done by others.

Statement Question: Senior school library has 27,600 books and junior school library has 10,545 books. How many more books does the senior school library has?

Rolly:

```
      9 10
  2 7 6 ~~0~~ ~~0~~
- 1 0 5 4 5
  0 7 1 5 5
```

LIVEWORKSHEETS

Polly:

$$\begin{array}{r} 27600 \\ +\ 10545 \\ \hline 38145 \end{array}$$

Molly:

$$\begin{array}{r} 5\ 9\ 10 \\ 2\ 7\ \cancel{6}\ \cancel{0}\ \cancel{0} \\ -\ 1\ 0\ 5\ 4\ 5 \\ \hline 1\ 7\ 0\ 5\ 5 \end{array}$$

Subtraction Pyramid

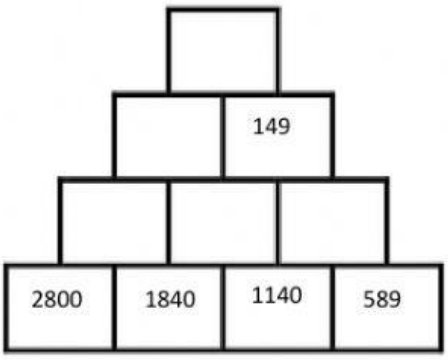

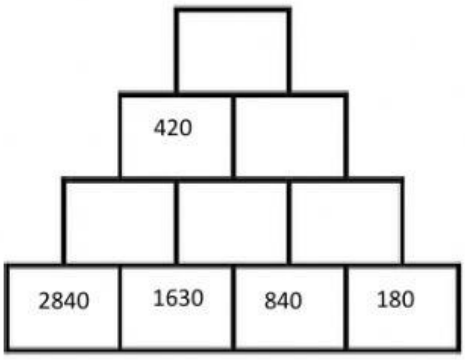

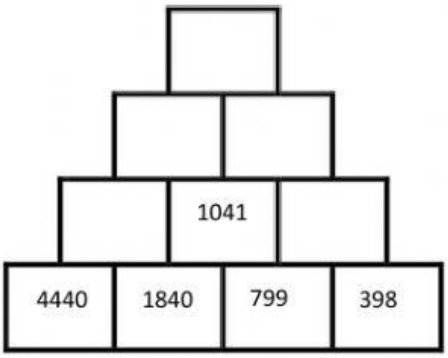

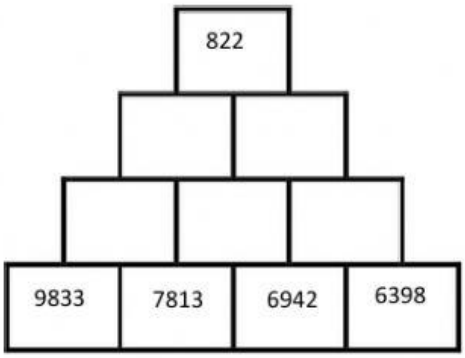

LIVEWORKSHEETS