DIVISION OF LENGTH

1.) 7 cm 2 mm ÷ 3 = ____ cm ____mm

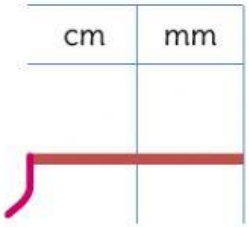

2.) 16 cm 8 mm ÷ 6 = _____ mm

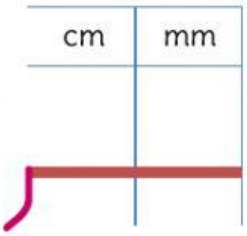

3.) 2 km 520 m ÷ 9 = _____m

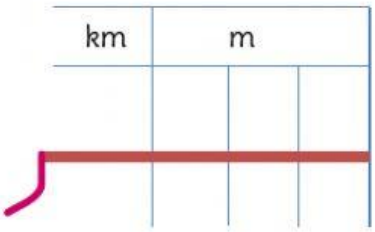

4.) 11 km 40 m ÷ 4 = _____ km _____ m

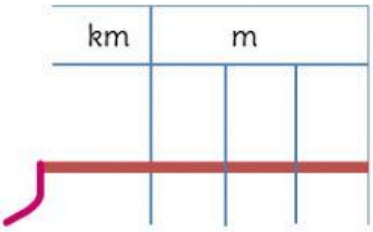

5.) 120 cm 8 mm of wood is used to make a picture frame of a regular octagonal frame as shown. What is the length of one side of the frame in mm?

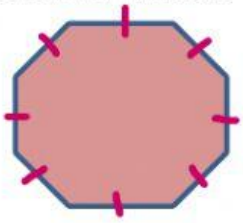

Answer: mm

LIVEWORKSHEETS