Latih Diri 9.2b

1. Cari nilai p dalam setiap segi tiga yang berikut.

(a)

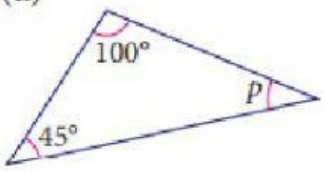

$45° + 100° + p = \quad °$

$° + p = \quad °$

$p = \quad ° - \quad °$

$p = \quad °$

Hasil tambah sudut pedalaman suatu segi tiga

(b)

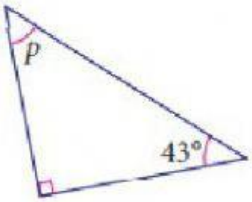

$90° + 43° + p = \quad °$

$° + p = \quad °$

$p = \quad ° - \quad °$

$p = \quad °$

Hasil tambah sudut pedalaman suatu segi tiga

(c)

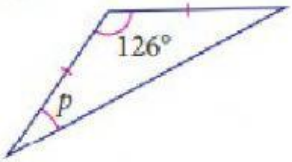

$126° + p + p = \quad °$

$126° + \quad 2p = \quad °$

$2p = \quad ° - \quad °$

$2p = \quad °$

$p = \dfrac{\quad °}{2}$

$p = \quad °$

Hasil tambah sudut pedalaman suatu segi tiga

(d)

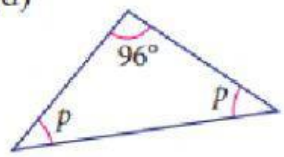

$96° + p + p = \quad °$

$96° + \quad 2p = \quad °$

$2p = \quad ° - \quad °$

$2p = \quad °$

$p = \dfrac{\quad °}{2}$

$p = \quad °$

LIVEWORKSHEETS

LIVEWORKSHEETS