ชื่อ_____ชั้น ม.3/_____เลขที่ _____

ลองคิด ลองทำ

คำชี้แจง : ให้นักเรียนพิจารณารูปแต่ละคู่ที่กำหนดให้ต่อไปนี้ว่าคล้ายกันหรือไม่

รูปเรขาคณิต	คล้ายกันหรือไม่
1.	
2. 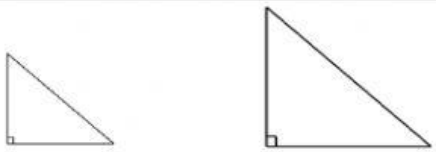	
3. 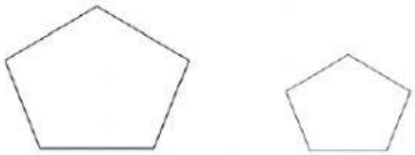	
4. 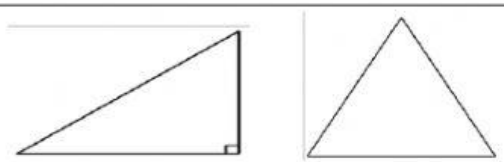	
5.	
6. 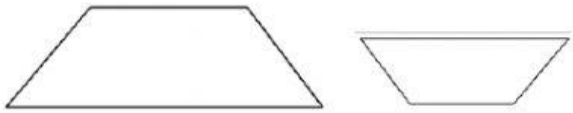	
7. 	
8. 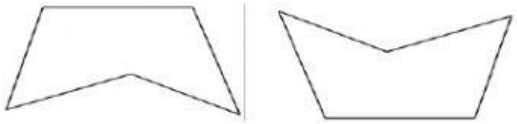	

LIVEWORKSHEETS