Converse of the Pythagorean Theorem

State if each triangle is a right triangle

1)

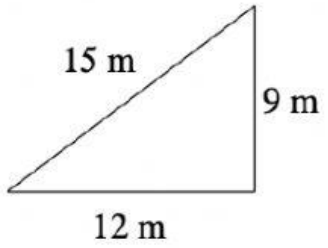

2)

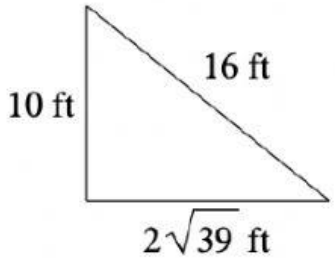

3)

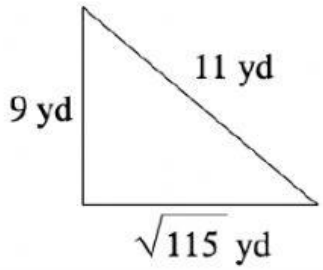

4)

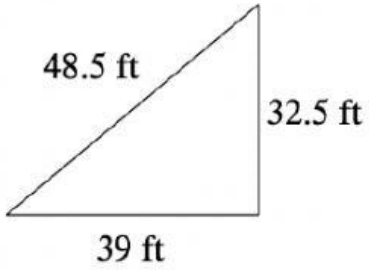

State if the three sides form an acute, an obtuse or a right triangle

5) $6m, 2\sqrt{55}m, 17m$	6) $4.8km, 28.6km, 29km$

State if each triangle is an acute, an obtuse or a right triangle

7)

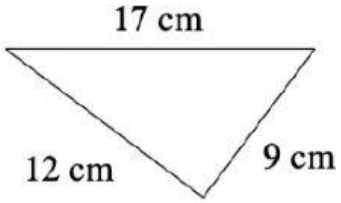

8)

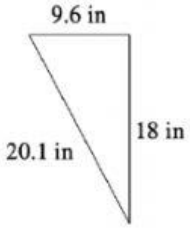

LIVEWORKSHEETS