Circle Constructions

Locate the center of each circle.

1)



2)



Construct a line segment tangent to the circle through the given point.

3)

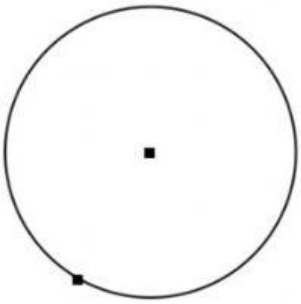

4)

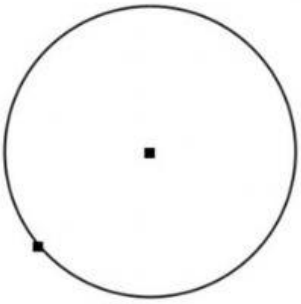

LIVEWORKSHEETS