Menyelesaikan masalah operasi tolak lingkungan 1-20.

1. Marie ada 16 sosej.
   Dia makan 7 sosej.
   Berapa baki sosej yang tinggal?

[ ] - [ ] = [ ]

2. Datuk petik 20 epal.
   10 epal diberi kepada ayah.
   Berapa baki epal yang tinggal?



[ ] - [ ] = [ ]

3. Ila ada 11 cincin.
   7 cincin diberi kepada Aina.
   Berapa baki cincin yang tinggal?

[ ] - [ ] = [ ]

4. Ada 8 pokok di taman.
   5 pokok ditebang.
   Berapa baki pokok yang tinggal?



[ ] - [ ] = [ ]

LIVEWORKSHEETS

5. Sangkar B ada 15 burung.

4 burung telah mati.

Berapa baki burung yang hidup?



[ ] - [ ] = [ ]

6. Ayub ada 9 pensil.

3 pensilnya patah.

Berapa baki pensil yang tinggal?



[ ] - [ ] = [ ]

7. Taman Mawar ada 10 rumah.

3 rumah roboh.

Berapa baki rumah yang tinggal?

[ ] - [ ] = [ ]

8. Mail ada 13 guli.

6 gulinya hilang.

Berapa baki guli yang tinggal?

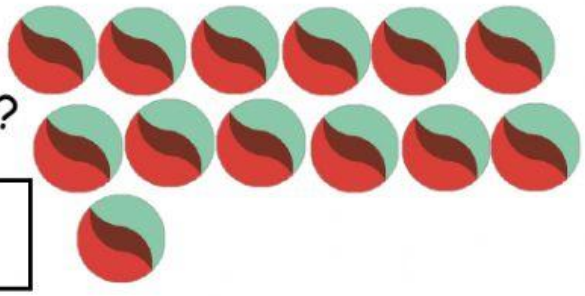

[ ] - [ ] = [ ]

LIVEWORKSHEETS

9. Ikin beli 6 susu.

1 susu telah basi.

Berapa baki susu yang elok?

[ ] - [ ] = [ ]

10. Kedai A jual 17 topi.

Abu beli 3 topi.

Berapa baki topi yang tinggal?



[ ] - [ ] = [ ]

11. Ada 12 lilin.

9 lilin terpadam.

Berapa baki lilin yang menyala?

[ ] - [ ] = [ ]

12. Ibu beli 18 telur.

2 telur pecah.

Berapa baki telur yang tinggal?



[ ] - [ ] = [ ]

LIVEWORKSHEETS

13. Kelas Dinamik ada 14 murid.

0 murid tidak hadir.

Berapa baki murid yang hadir?

[ ] - [ ] = [ ]

14. Ada 20 paku di dalam kotak.

5 paku hilang.

Berapa baki paku yang tinggal?

[ ] - [ ] = [ ]

15. Baju Akid ada 7 butang.

3 butang bajunya tercabut.

Berapa baki butang yang tinggal?



[ ] - [ ] = [ ]

LIVEWORKSHEETS