Nama :

Kelas :

Menentukan pecahan senilai

Menentukan nilai pecahan untuk bagian yang diberi warna

1)

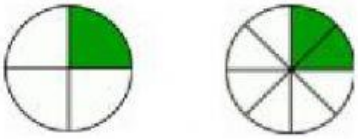

$\frac{1}{4} = \frac{2}{8}$

2)

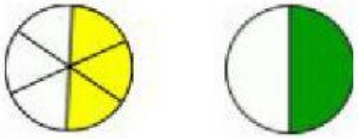

___ = ___

3)

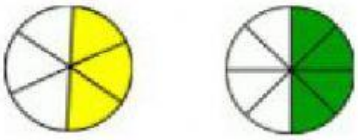

___ = ___

4)

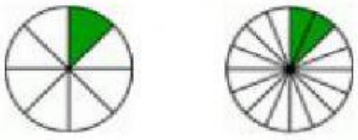

___ = ___

5)

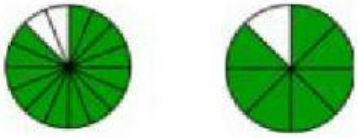

___ = ___

6)

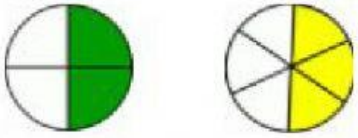

___ = ___

7)

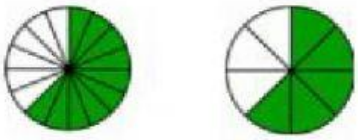

___ = ___

8)

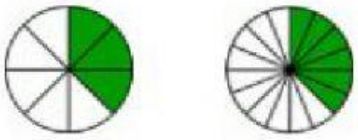

___ = ___

LIVEWORKSHEETS