GIMNASIO BILINGÜE CAMPESTRE MARIE CURIE
Resolución de aprobación No. 647 del 28 de Noviembre de 2018 (SEC)
"Everything humankind has created originates within the mind so, develop your mind and it will make an invaluable contribution"

Math Final Exam
First Term
Kinder _____

Name: _____ date: _____

1. Ana Maria has 23 pearls, count and circle them.



2. Write How many tens and ones we have in A and B.

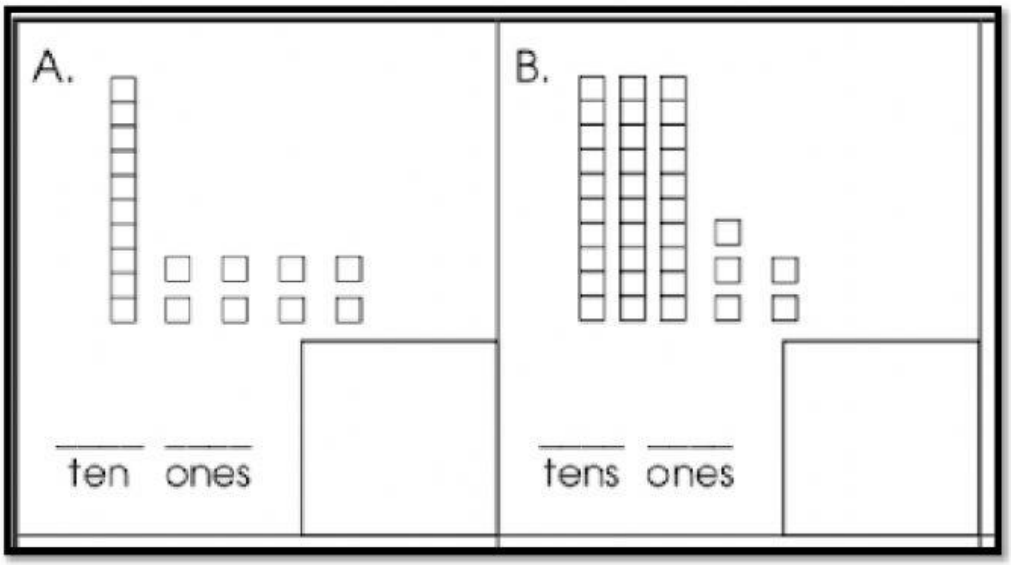

LIVEWORKSHEETS

3. Color tens and ones to show each number.

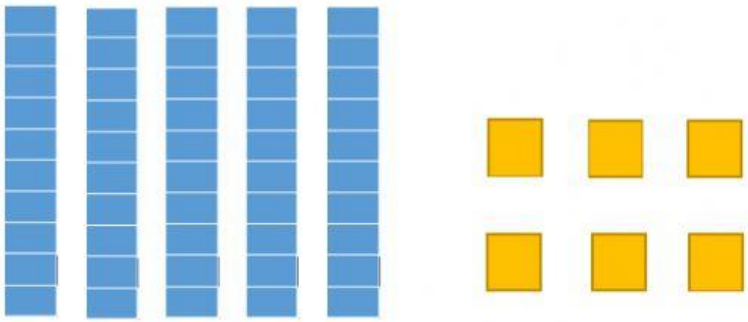

22	14
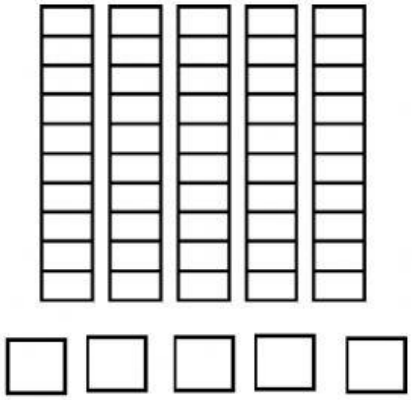	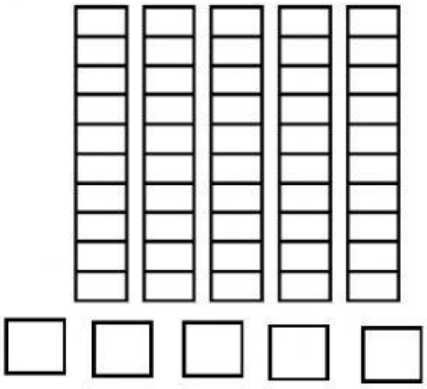

4. Describe the shape by selecting the correct option.



4 vertices	Yes	No
3 sides	Yes	No

4 sides	Yes	No
Curve line	Yes	No

LIVEWORKSHEETS

5. How I can make 20? Write two ways.

☐ + ☐ = 20

☐ + ☐ = 20

2 10 4

10 16 1

LIVEWORKSHEETS