# ATIVIDADE -5:

## Questão 1

Ligue os ângulos que são **congruentes**:

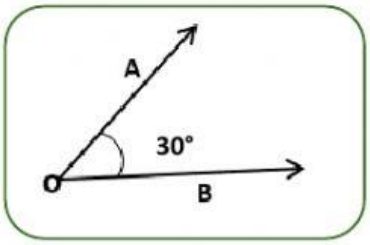


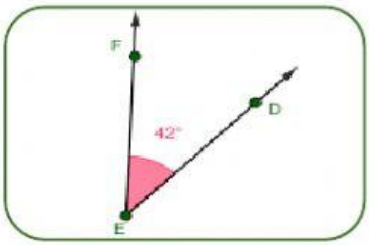


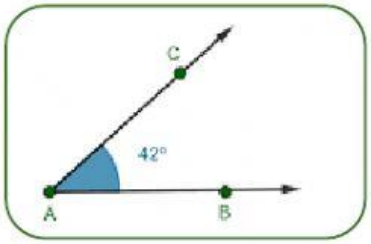


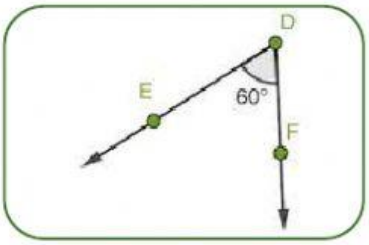


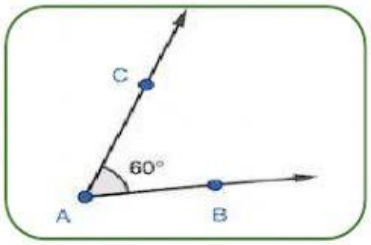


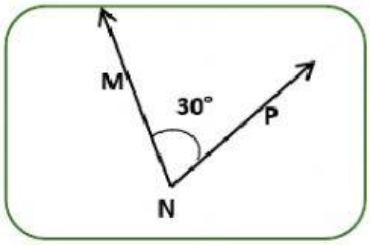


## Questão 2

Observe a figura abaixo e marque os pares de ângulos adjacentes.

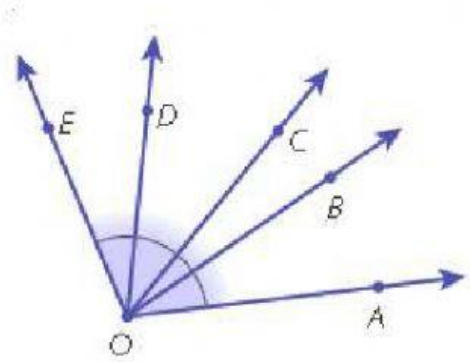


a) ( ) AÔB e BÔC
b) ( ) BÔE e CÔD
c) ( ) CÔD e DÔE
d) ( ) AÔD e DÔE
e) ( ) AÔC e CÔD
f) ( ) AÔC e CÔE


LIVEWORKSHEETS

## Questão 3

Determine o **valor de x**, em graus, em cada figura abaixo:

a)

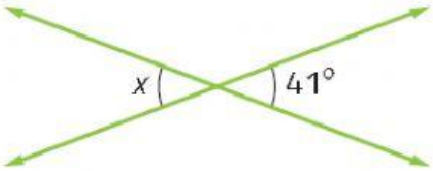


**x =** °

b)

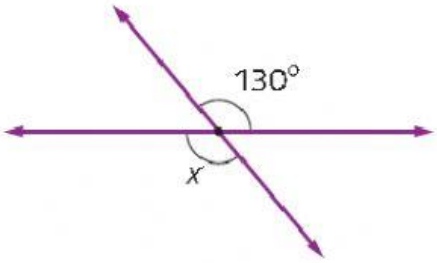


**x =** °

c)

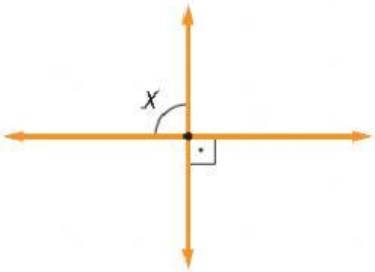


**x =** °


LIVEWORKSHEETS