Recognize and determine the coordinates.

1. The diagram shows the positions of several shapes on a Cartesian plane.

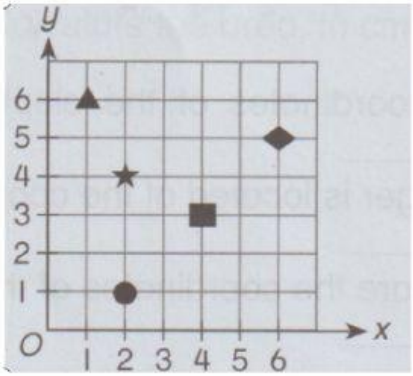

Complete the table based on the Cartesian plane.

Shape	Coordinates
●	
★	
▲	
◆	
■	

2. The diagram below shows a Cartesian plane.

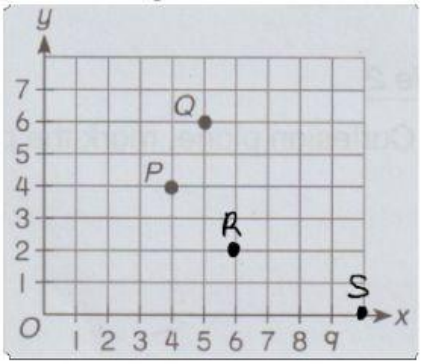

The coordinates of the points P _____

The coordinates of the points Q _____

The coordinates of the points R _____

The coordinates of the points S _____

3. Answer the questions based on the Cartesian plane below.

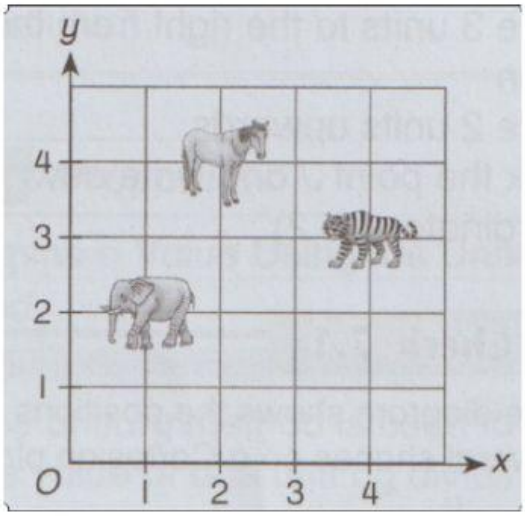

The coordinates of the elephant are _____.

The tiger is located at the coordinates _____.

(2,4) are the coordinates of the _____.

LIVEWORKSHEETS