Escola Municipal Ayrton Senna

Agosto Lilás
Campanha de Conscientização e Prevenção contra a Violência Contra a Mulher
UM MÊS UMA COR UMA LUTA

MATEMATICA

1- ESCREVA O NOME DE CADA FIGURA ABAIXO:
(Clicar no quadro e digitar).

2- RESOLVA OS PROBLEMINHAS BAIXO: (Clicar no quadro e digitar).

A) LUCAS TINHA TRÊS BOLAS E GANHOU MAIS DUAS. QUANTAS BOLAS ELE TEM AGORA?

+ =

B) ALICE TINHA CINCO BONECAS E GANHOU MAIS DUAS. QUANTAS BONECAS ELA TEM AGORA?

+ =

C) ARTHUR TEM QUATRO PIPAS E GANHOU MAIS QUATRO. QUANTAS PIPAS ELE TEM AGORA?

+ =

LIVEWORKSHEETS

NOME:

DATA:

SOMANDO COM AS PEÇAS DO DOMINÓ



4 + 6 = 10

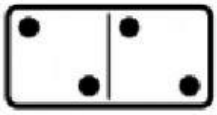

__ + __ = __

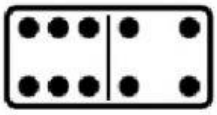

__ + __ = __

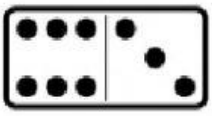

__ + __ = __

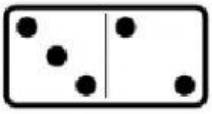

__ + __ = __



__ + __ = __



__ + __ = __

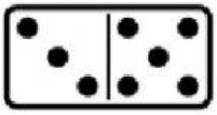

__ + __ = __

LIVEWORKSHEETS