Lengkapkan peta pemikiran di bawah. Kemudian, bentangkan.

Contoh jawapan: 2 sudut tirus

Bentuk

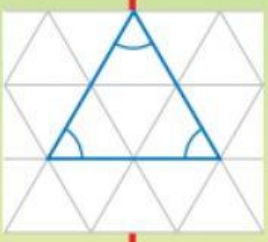

segi tiga sama sisi

- ☐ sudut tirus
- ☐ sisi sama panjang

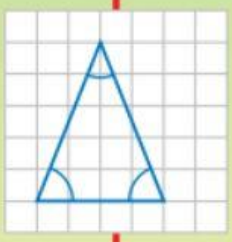

segi tiga sama kaki

- ☐ sudut tirus
- ☐ sisi sama panjang

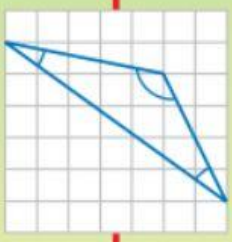

segi tiga tak sama kaki

- ☐ sudut cakah
- ☐ sudut tirus
- ☐ sisi tak sama panjang

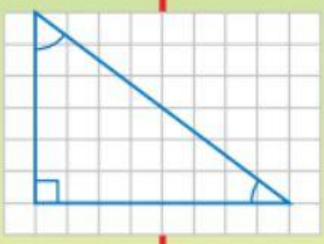

segi tiga bersudut tegak

- ☐ sudut tegak
- ☐ sudut tirus

UJI DIRI

1 Label dan namakan sudut pada bentuk berikut.

a

b 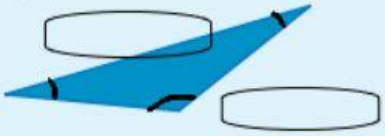

c 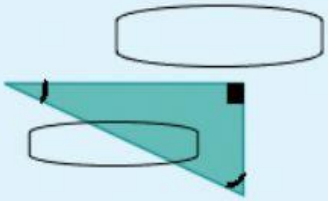

2 Sudut ☐ lebih besar daripada sudut ☐. (cakah, tirus)

LIVEWORKSHEETS