Inequalities

Instruction: For each inequality shown, select the values for x from the number line that matches that inequality.

1) $x<9$

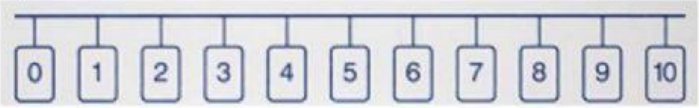

2) $x > 5$

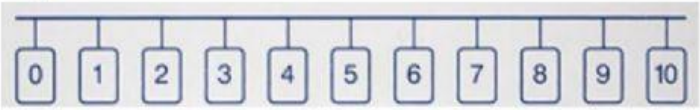

3) $x\geq 10$

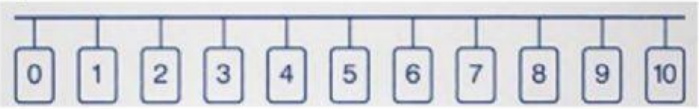

4) $x\leq 3$

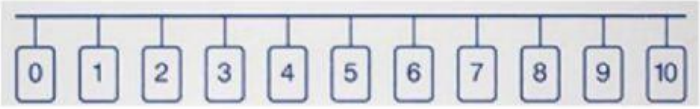

5) $1\leq x<5$

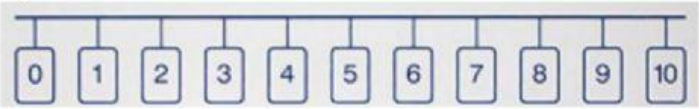

6) $4<2x\leq 6$

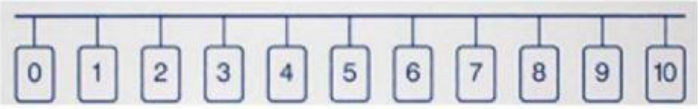

Click Finish and then Check my Answers to review your answers

LIVEWORKSHEETS