Mathematics: Grade 3 : Week 14:

1. Mathematics

1. Write the number numeral:			
Seven hundred and twenty-one		Seven hundred and twenty-two	
Seven hundred and twenty-three		Seven hundred and twenty-four	
Seven hundred and twenty-five		Seven hundred and twenty-six	

2. Complete the sums:

720 + 9 =	700 + = 773	770 + = 790	769 - 9 =
720 + 15 =	700 + = 774	770 + = 780	747 - 7 =
730 + 30 =	700 + = 776	770 + = 792	785 - 80 =

3. Fill in the missing numbers:

700	710	720							

4. Decompose (breaking up numbers)

H T U		
+ + = 793	700+90+2 =	8+40+700=

5. Write the following numbers from smallest to biggest:

276	444	352	177	464	575	372	193	864	762

6. Round of to the nearest 10

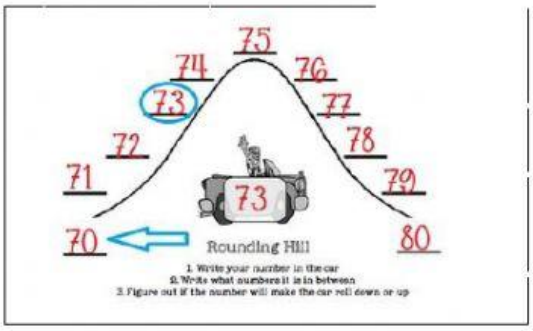

623		625	
547		636	

LIVEWORKSHEETS

Mathematics: Grade 3: Week 14:

Write the repeated addition and multiplication sentences that's illustrated in each picture. The first one has been done for you

1.		+) 3 + 3 + 3 = 9 x) 3 X 3 = 9
2.		+) x)
3.		+) x)
4.		+ x)
5.		+) x)
6.		+) x)
7.		+) x)
8.		+) x)
9.		+) x)

LIVEWORKSHEETS