1. **Conte as quantidades em cada grupo e ligue ao numeral correspondente:**



18

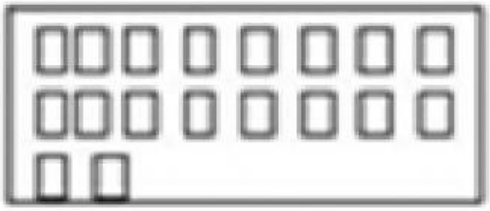

14

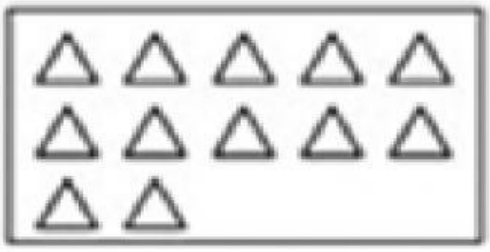

20

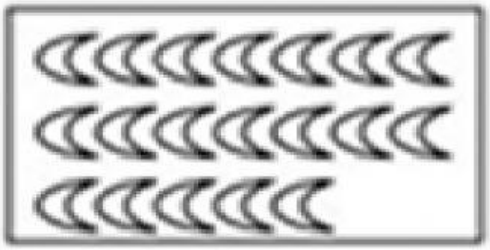

12



19

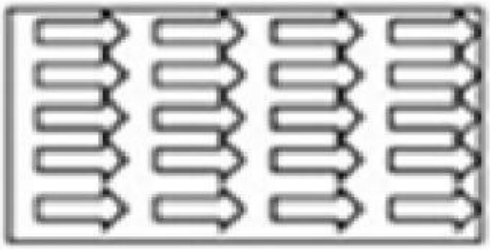

15

LIVEWORKSHEETS

2. Conte:

10 + 1 = _____ 10 + 6 = _____

10 + 2 = _____ 10 + 7 = _____

10 + 3 = _____ 10 + 8 = _____

10 + 4 = _____ 10 + 9 = _____

10 + 5 = _____ 10 + 10 = _____

3. Escreva a seqüência numérica de 1 a 20.

1				

LIVEWORKSHEETS

4. Escreva os números vizinhos:

	16	
	14	
	10	
	19	
	17	

	12	
	18	
	13	
	11	
	16	

LIVEWORKSHEETS