ASAS ISIPADU

NAMA : **KELAS :**

Hitung isipadu kubus dan kuboid di bawah.

216 cm^3	512 cm^3	1 cm^3	30 cm^3	180 cm^3	120 cm^3	32 cm^3	72 cm^3

1.

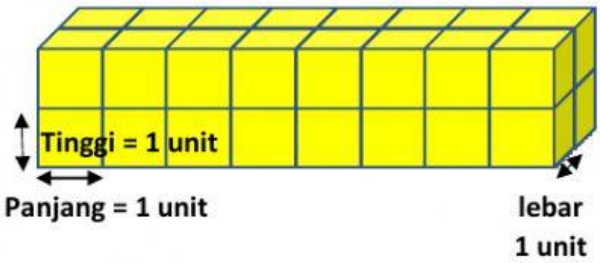

Isipadu satu kubus = _____

Isipadu seluruh rajah = _____

2.

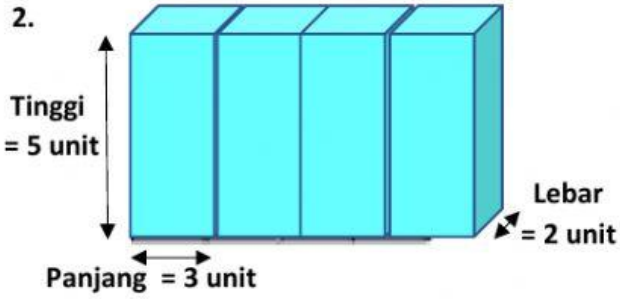

Isipadu satu kuboid = _____

Isipadu seluruh rajah = _____

3.

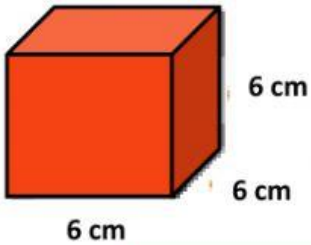

Isipadu seluruh rajah = _____

4.

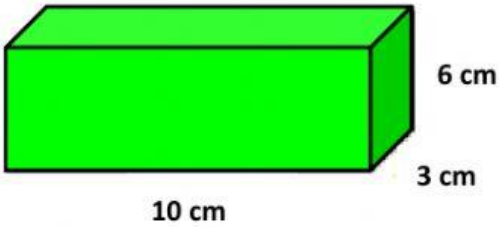

Isipadu seluruh rajah = _____

5. Kira jumlah isipadu kubus dan kuboid di bawah.

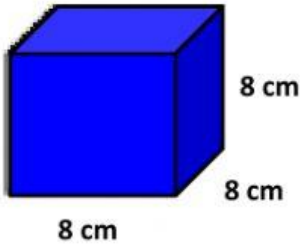

Isipadu seluruh rajah = _____

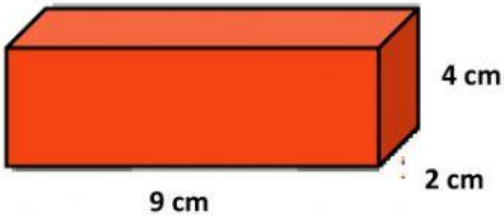

Isipadu seluruh rajah = _____

LIVEWORKSHEETS