KENALI WANG

NAMA : _____

Namakan ciri-ciri wang berikut.

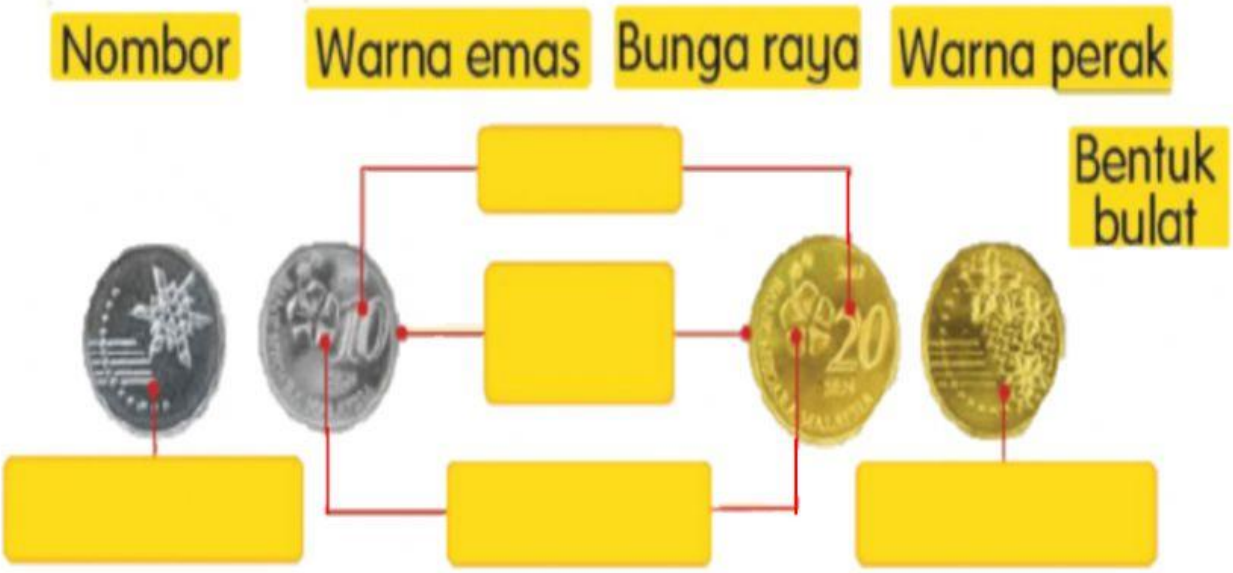



LIVEWORKSHEETS

Suaikan pasangan wang dengan betul.

LIVEWORKSHEETS

Pilih nilai wang yang betul.

RM 1 | RM 5

50 sen | 5 sen

5 sen | 10 sen

RM 10 | RM 1

20 sen | 10 sen

RM 1 | RM 10

5 sen | 20 sen

LIVEWORKSHEETS

Padankan wang berikut dengan harga barang.



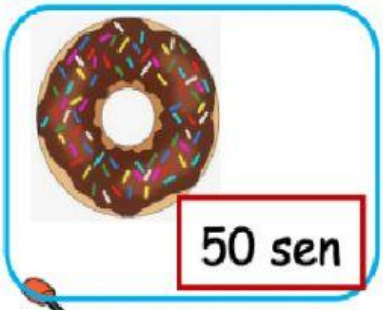

LIVEWORKSHEETS