Compound Shapes

Find the perimeter of each figure

1)

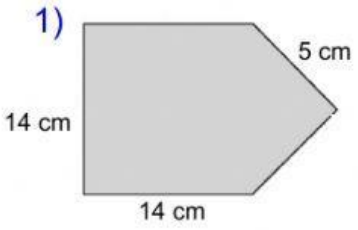

Perimeter: _____

2)

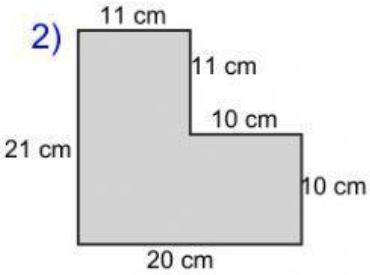

Perimeter: _____

3)

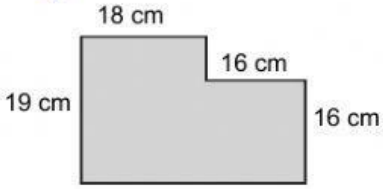

Perimeter: _____

4)

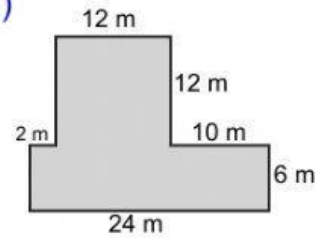

Perimeter: _____

5)

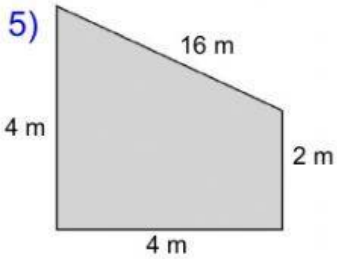

Perimeter: _____

6)

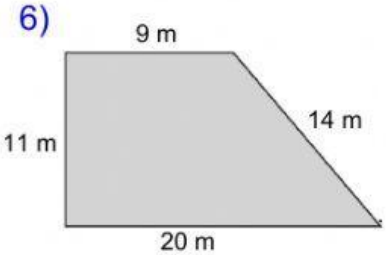

Perimeter: _____

7)

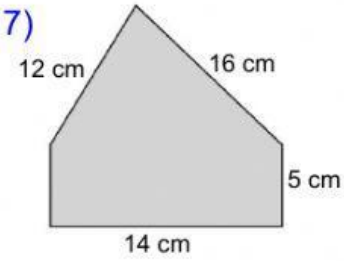

Perimeter: _____

8)

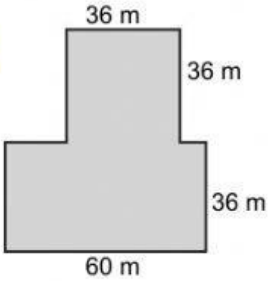

Perimeter: _____

9)

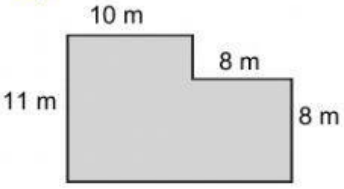

Perimeter: _____

LIVEWORKSHEETS

LIVEWORKSHEETS