Name _____ Date _____

Year Group _____

Find the area of the following figures (1-4) if each square is

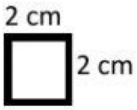

1.

Answer = _____ cm

2.

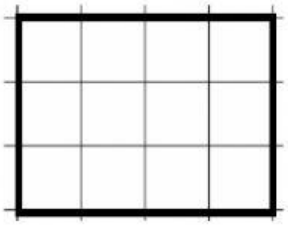

Answer = _____ cm

3.

Answer = _____ cm

4.

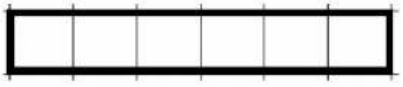

Answer = _____ cm

Find the area of the following figures (5-8) if each square is

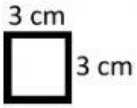

5.



Answer = _____ cm

6.



Answer = _____ cm

7.

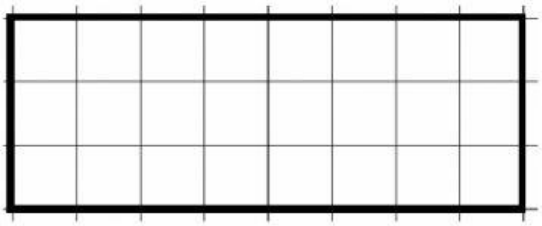

Answer = _____ cm

8.

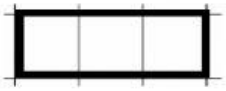

Answer = _____ cm

LIVEWORKSHEETS