**Write the answer in the box given.**

## SELF-TEST

Solve these.

a. What is the fraction for each part of this apple?



b. Ani eats a quarter of an omelette. What is the fraction?



c. Lim divides a piece of paper into four equal parts. He draws 3 parts with patterns. Name the fraction of parts with patterns.



d. Johan drinks half a bottle of juice. Which juice is it?

LIVEWORKSHEETS