1 Tulis jarak mengufuk dan mencancang di antara titik-titik dalam satah berikut.

a

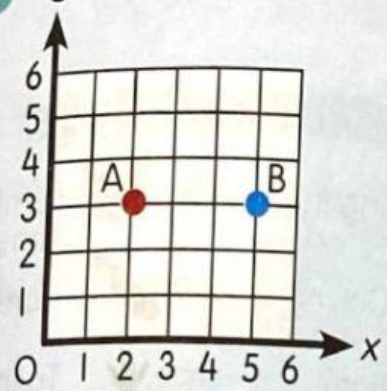

Dari ____ ke ____

Jarak mengufuk: ____ unit

Jarak mencancang: ____ unit

b

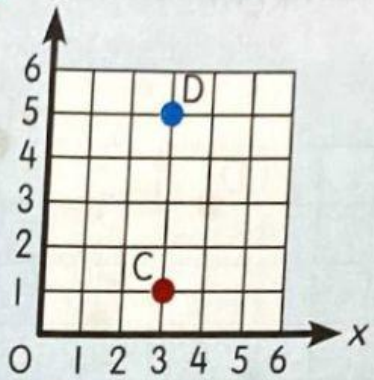

Dari ____ ke ____

Jarak mengufuk: ____ unit

Jarak mencancang: ____ unit

c

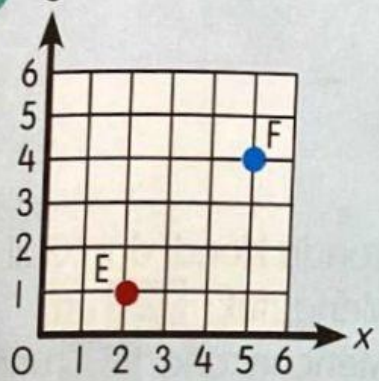

Dari ____ ke ____

Jarak mengufuk: ____ unit

Jarak mencancang: ____ unit

d

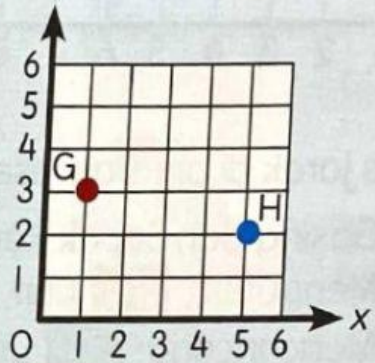

Dari ____ ke ____

Jarak mengufuk: ____ unit

Jarak mencancang: ____ unit

LIVEWORKSHEETS