ROMBOIDE | RETTANGOLO | ROMBO | QUADRATO

OSSERVA I SIMBOLI UTILIZZATI PER LATI E ANGOLI, CLICCA SULLA CASELLA GIUSTA E SPOSTA I CARTELLINI CHE TROVI SOPRA IN CORRISPONDENZA DEL POLIGONO GIUSTO.



	angoli	lati	
figura A 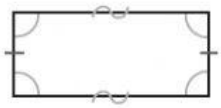	☐ uguali e retti ☐ uguali a due a due ☐ due acuti e due ottusi	☐ uguali a due a due ☐ tutti uguali	Si chiama
figura B 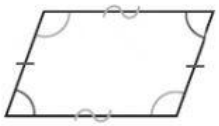	☐ uguali e retti ☐ uguali a due a due ☐ due acuti e due ottusi	☐ uguali a due a due ☐ tutti uguali	Si chiama
figura C 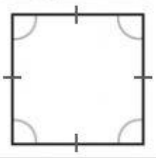	☐ uguali e retti ☐ uguali a due a due ☐ due acuti e due ottusi	☐ uguali a due a due ☐ tutti uguali	Si chiama
figura D 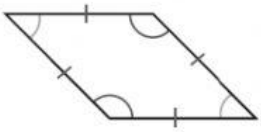	☐ uguali e retti ☐ uguali a due a due ☐ due acuti e due ottusi	☐ uguali a due a due ☐ tutti uguali	Si chiama

SPOSTA CIASCUN CARTELLINO CON IL NOME SOTTO AL PARALLELOGRAMMA GIUSTO, POI COLLEGA CIASCUN POLIGONO AL CARTELLINO GIUSTO PER LE DIAGONALI



.....

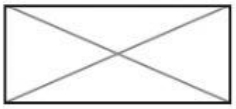

.....



.....

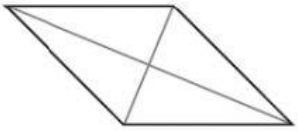

.....

QUADRATO | ROMBO | ROMBOIDE | RETTANGOLO

DIAGONALI UGUALI

DIAGONALI NON UGUALI

LIVEWORKSHEETS