LEMBAR KERJA PESERTA DIDIK (LKPD)

SISTEM REPRODUKSI MANUSIA-HEWAN-TUMBUHAN

PASANGKANLAH ANTARA GAMBAR DENGAN ISTILAH/PENGERTIAN/FUNGSI

Nama/Kelas :.....

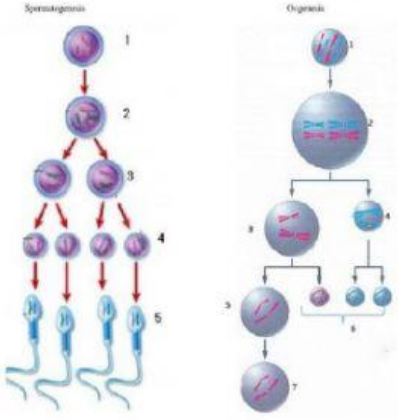

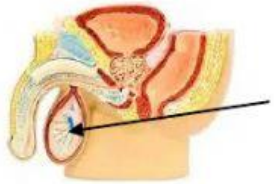

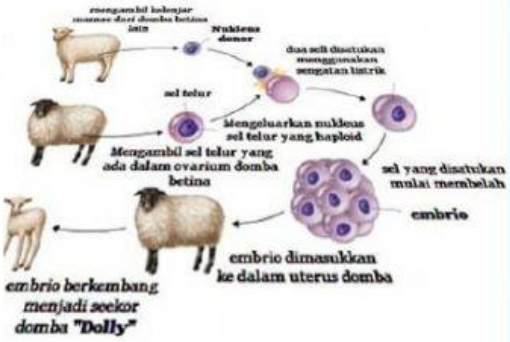

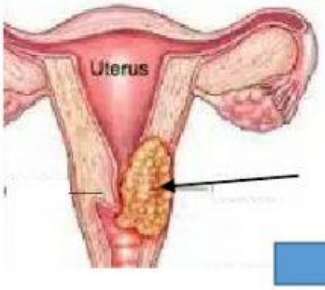

- Mitosis & Meiosis
- Inseminasi
- Kultur Jaringan
- Kloning
- Testis
- Materi Genetik
- Media Tanam
- Kanker Serviks
- Hibridisasi
- Ovarium

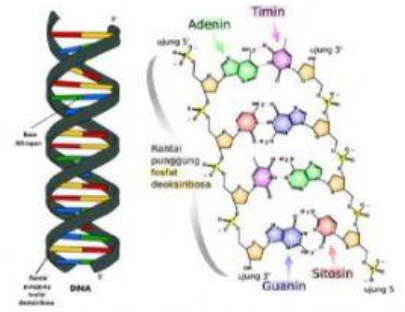

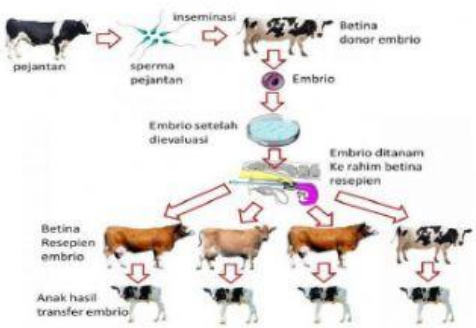

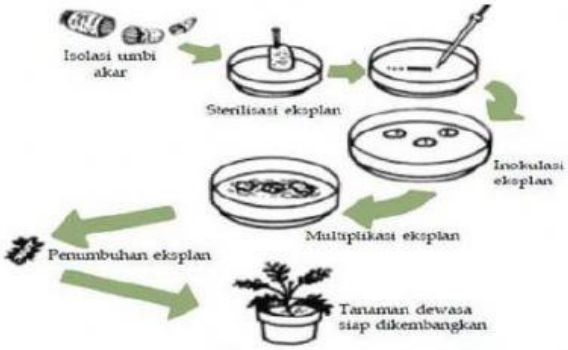

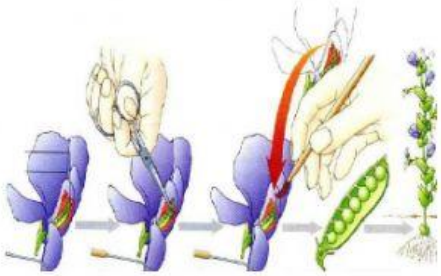

LIVEWORKSHEETS