COMPLETA LE SOTTRAZIONI E GLI SCHEMI. OSSERVA L'ESEMPIO.

1

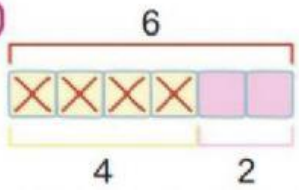

6 – 4 = 2

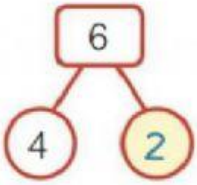

2

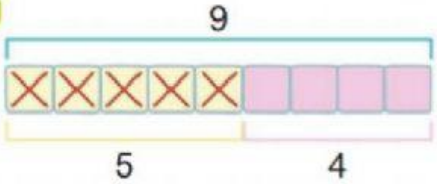

9 – 5 = ___

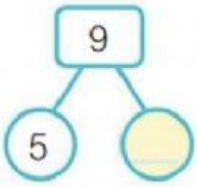

3

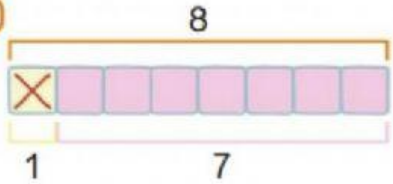

8 – 1 = ___

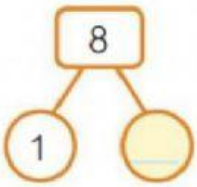

4 CONTA I QUADRETTI, COMPLETA LE SOTTRAZIONI E GLI SCHEMI.

7 – ___ = 4

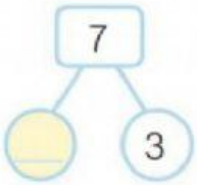

LIVEWORKSHEETS