Kira luas rajah di bawah:

(a)

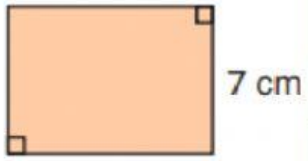

cm^2

(b)

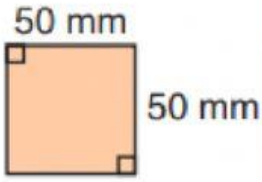

mm^2

(c)

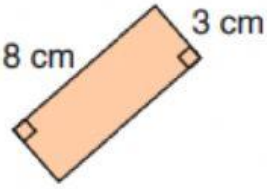

cm^2

(d)

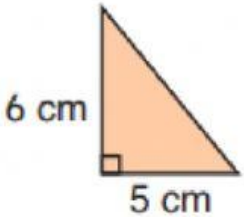

cm^2

(e)

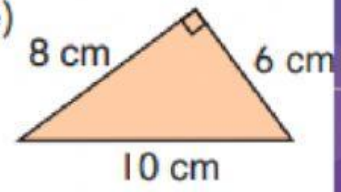

cm^2

LIVEWORKSHEETS